Finding Angles within Shapes

Name:

Count the number of Acute, Obtuse, Right and Reflex angles in each shape.

Ex)

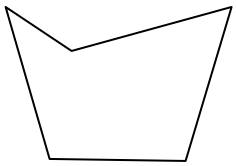

1)



2)

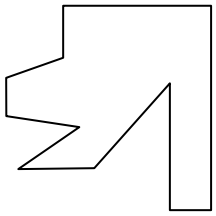

3)

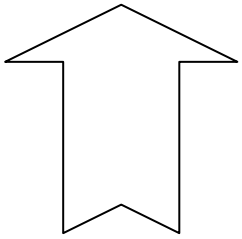

4)

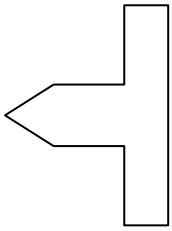

5)

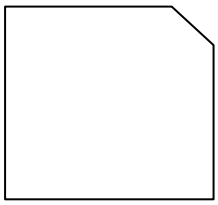

6)

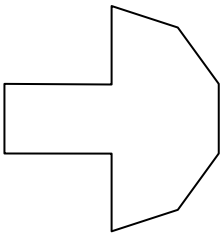

7)

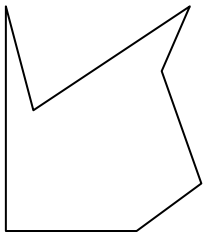

8)

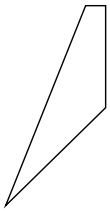

9)



10)



11)

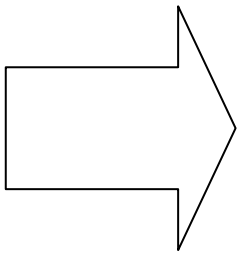

Answers

Ex.	2	2	0	1
1.				
2.				
3.				
4.				
5.				
6.				
7.				
8.				
9.				
10.				
11.				

1-10	91	82	73	64	55	45	36	27	18	9
11	0									

Finding Angles within Shapes

Name: **Answer Key**

Count the number of Acute, Obtuse, Right and Reflex angles in each shape.

Ex)

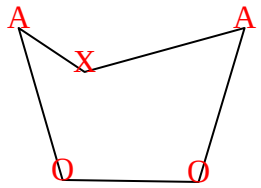

1)

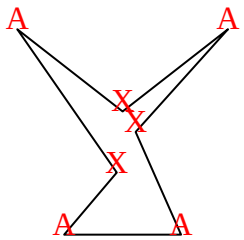

2)

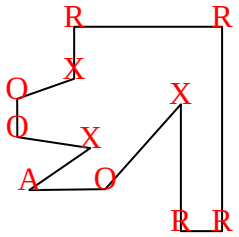

3)

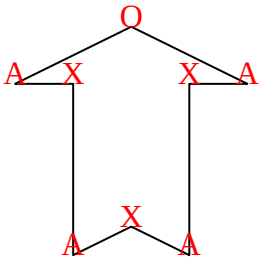

4)

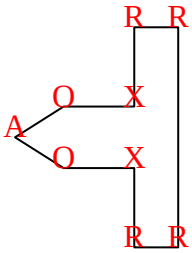

5)

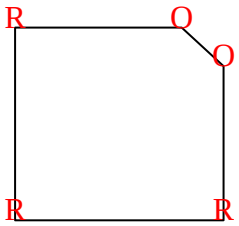

6)

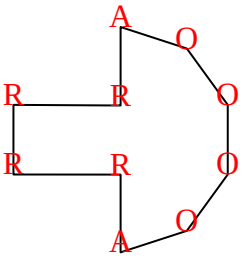

7)

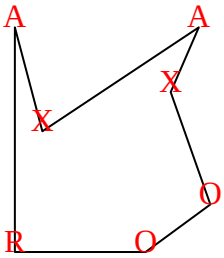

8)

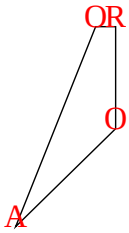

9)

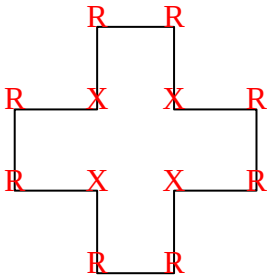

10)

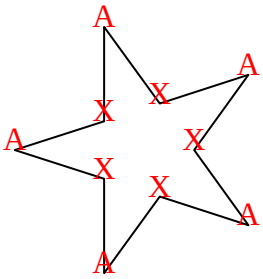

11)

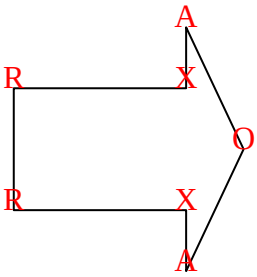

Answers

Ex.	2	2	0	1
1.	4	0	0	3
2.	1	3	4	3
3.	4	1	0	3
4.	1	2	4	2
5.	0	2	3	0
6.	2	4	4	0
7.	2	2	1	2
8.	1	2	1	0
9.	0	0	8	4
10.	5	0	0	5
11.	2	1	2	2

1-10	91	82	73	64	55	45	36	27	18	9
11	0									

Finding Angles within Shapes

Name:

Count the number of Acute, Obtuse, Right and Reflex angles in each shape.

Ex)



1)

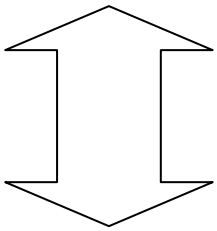

2)

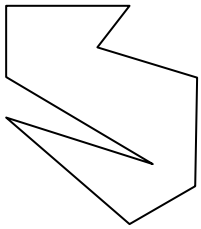

3)

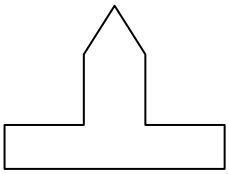

4)



5)

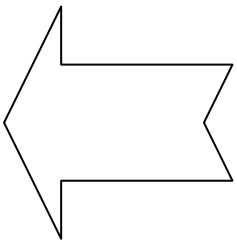

6)

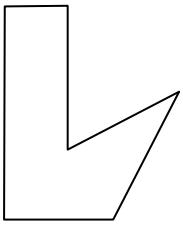

7)

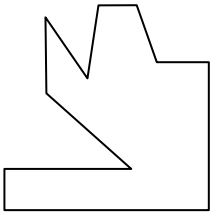

8)

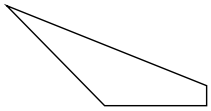

9)

10)

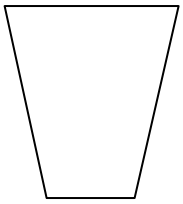

11)

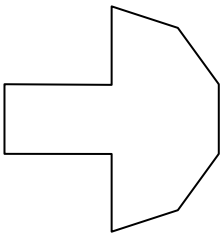

Answers

Ex.	5	0	0	5
1.				
2.				
3.				
4.				
5.				
6.				
7.				
8.				
9.				
10.				
11.				

1-10	91	82	73	64	55	45	36	27	18	9
11	0									

Finding Angles within Shapes

Name: **Answer Key**

Count the number of Acute, Obtuse, Right and Reflex angles in each shape.

Ex)

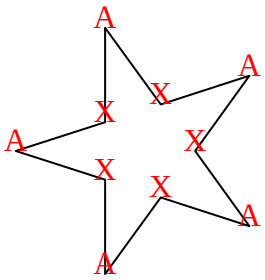

1)

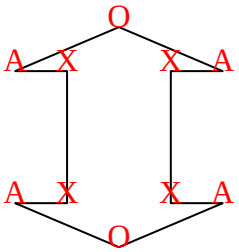

2)

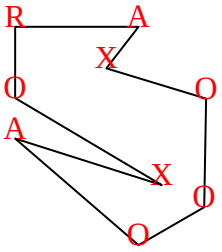

3)

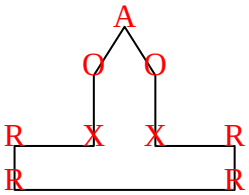

4)

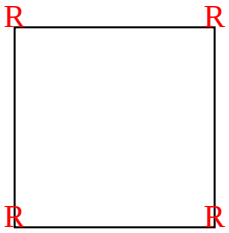

5)

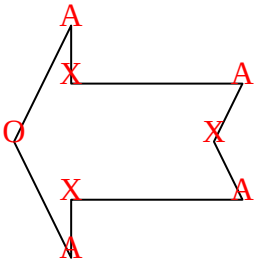

6)

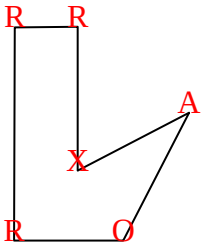

7)

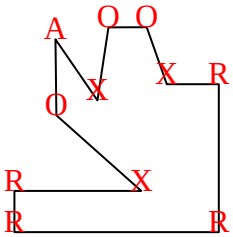

8)

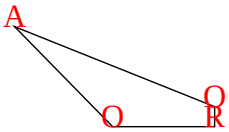

9)



10)

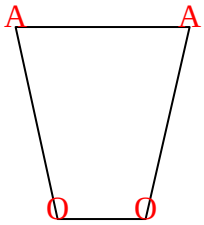

11)

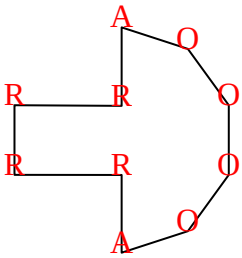

Answers

Ex.	5	0	0	5
1.	4	2	0	4
2.	2	4	1	2
3.	1	2	4	2
4.	0	0	4	0
5.	4	1	0	3
6.	1	1	3	1
7.	1	3	4	3
8.	1	2	1	0
9.	0	0	4	0
10.	2	2	0	0
11.	2	4	4	0

1-10	91	82	73	64	55	45	36	27	18	9
11	0									

Finding Angles within Shapes

Name:

Count the number of Acute, Obtuse, Right and Reflex angles in each shape.

Ex)

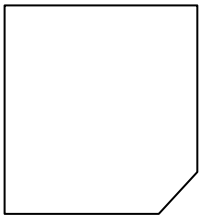

1)

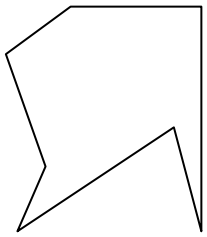

2)



3)

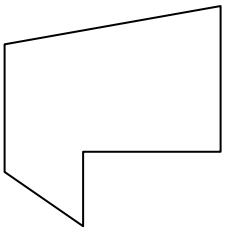

4)

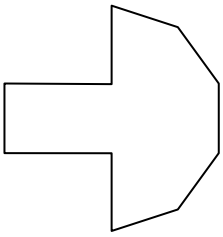

5)

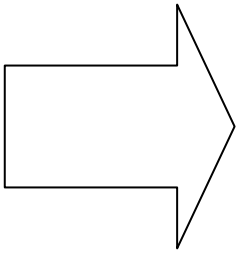

6)

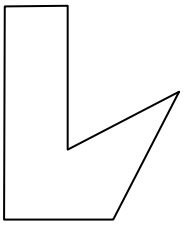

7)

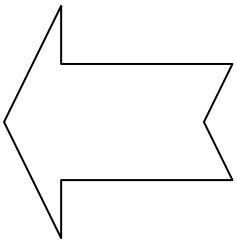

8)

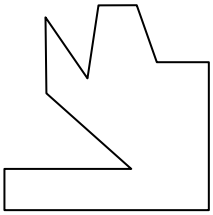

9)

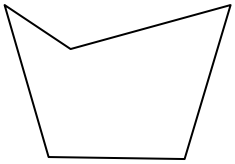

10)



11)



Answers

Ex.	0	2	3	0
1.				
2.				
3.				
4.				
5.				
6.				
7.				
8.				
9.				
10.				
11.				

1-10	91	82	73	64	55	45	36	27	18	9
11	0									

Finding Angles within Shapes

Name: **Answer Key**

Count the number of Acute, Obtuse, Right and Reflex angles in each shape.

Ex)

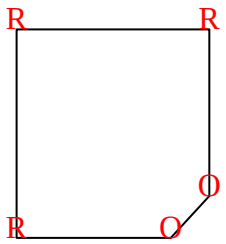

1)

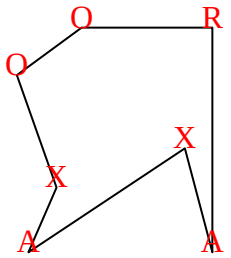

2)



3)

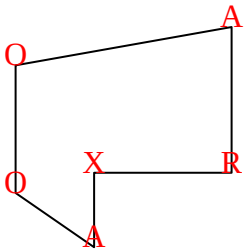

4)

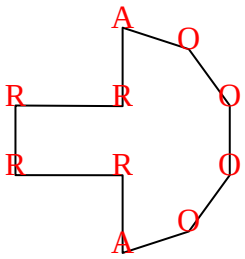

5)

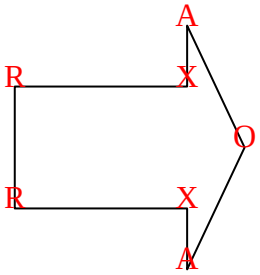

6)

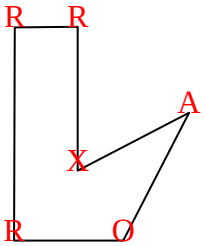

7)

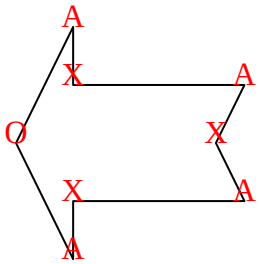

8)

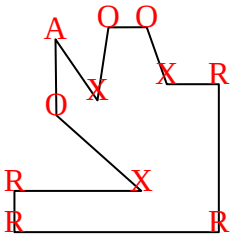

9)

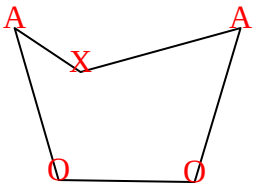

10)

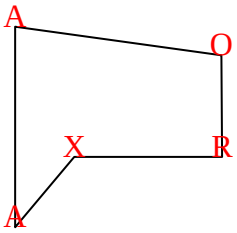

11)

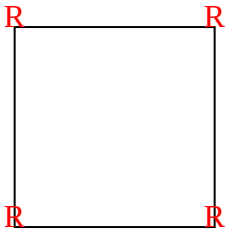

Answers

Ex.	0	2	3	0
1.	2	2	1	2
2.	0	0	4	0
3.	2	2	1	1
4.	2	4	4	0
5.	2	1	2	2
6.	1	1	3	1
7.	4	1	0	3
8.	1	3	4	3
9.	2	2	0	1
10.	2	1	1	1
11.	0	0	4	0

1-10	91	82	73	64	55	45	36	27	18	9
11	0									

Finding Angles within Shapes

Name:

Count the number of Acute, Obtuse, Right and Reflex angles in each shape.

Ex)

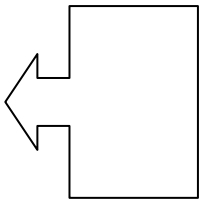

1)

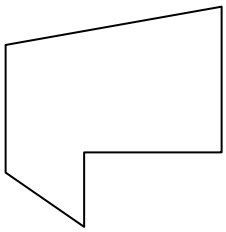

2)

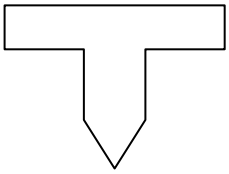

3)

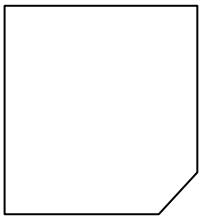

4)

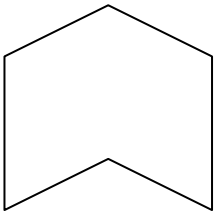

5)

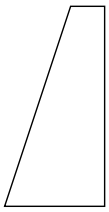

6)

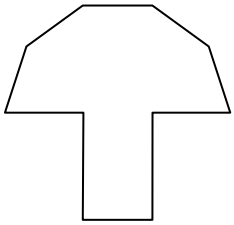

7)

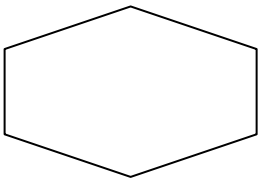

8)

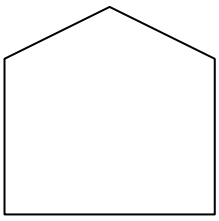

9)

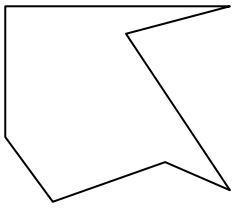

10)

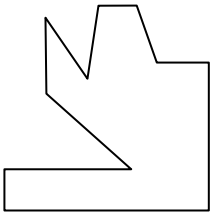

11)

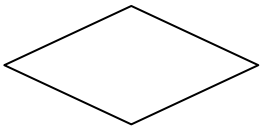

Answers

Ex.	2	1	4	4
1.				
2.				
3.				
4.				
5.				
6.				
7.				
8.				
9.				
10.				
11.				

1-10	91	82	73	64	55	45	36	27	18	9
11	0									

Finding Angles within Shapes

Name: **Answer Key**

Count the number of Acute, Obtuse, Right and Reflex angles in each shape.

Ex)

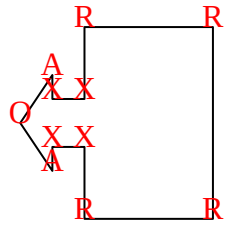

1)

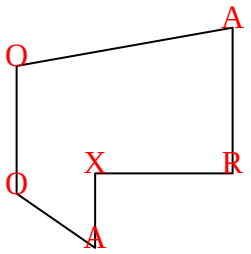

2)

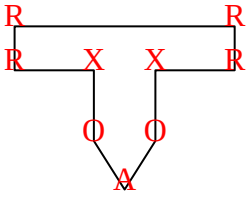

3)

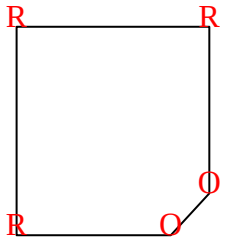

4)

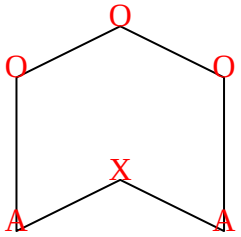

5)

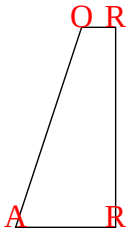

6)

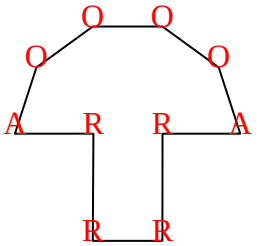

7)

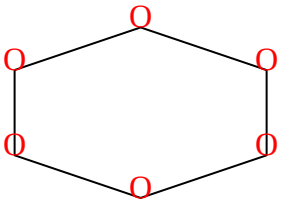

8)

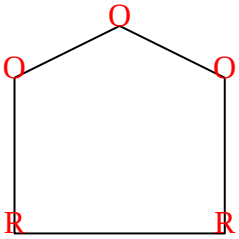

9)

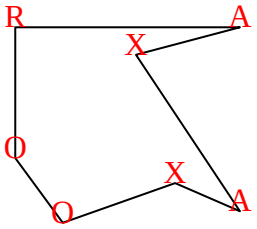

10)

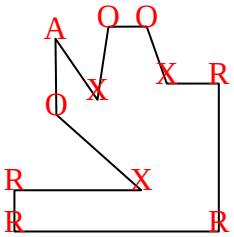

11)

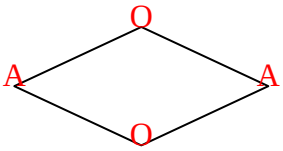

Answers

Ex.	2	1	4	4
1.	2	2	1	1
2.	1	2	4	2
3.	0	2	3	0
4.	2	3	0	1
5.	1	1	2	0
6.	2	4	4	0
7.	0	0	6	0
8.	0	3	2	0
9.	2	2	1	2
10.	1	3	4	3
11.	2	2	0	0

1-10	91	82	73	64	55	45	36	27	18	9
11	0									

Finding Angles within Shapes

Name:

Count the number of Acute, Obtuse, Right and Reflex angles in each shape.

Ex)



1)

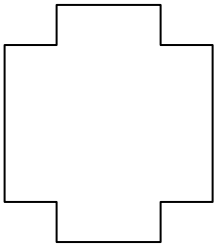

2)

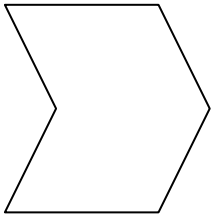

3)

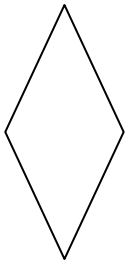

4)

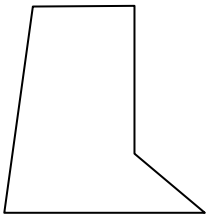

5)

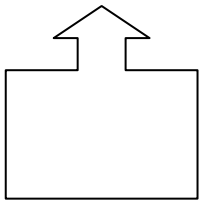

6)



7)

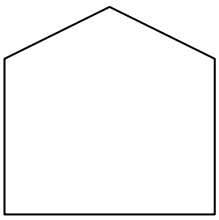

8)

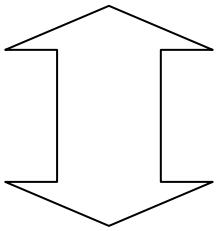

9)

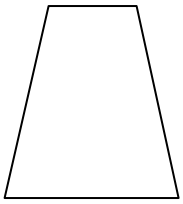

10)



11)

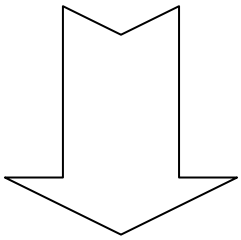

Answers

Ex.	4	0	0	3
1.				
2.				
3.				
4.				
5.				
6.				
7.				
8.				
9.				
10.				
11.				

1-10	91	82	73	64	55	45	36	27	18	9
11	0									

Finding Angles within Shapes

Name: **Answer Key**

Count the number of Acute, Obtuse, Right and Reflex angles in each shape.

Ex)

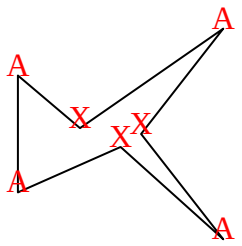

1)

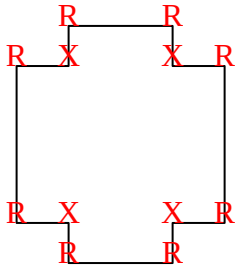

2)

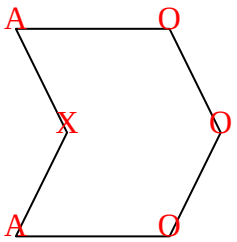

3)

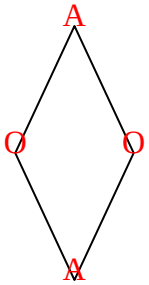

4)

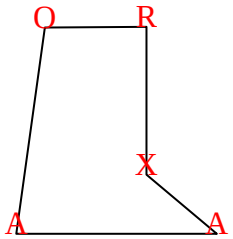

5)

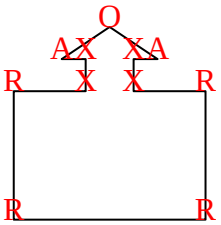

6)

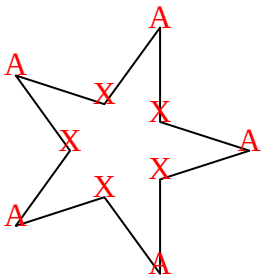

7)

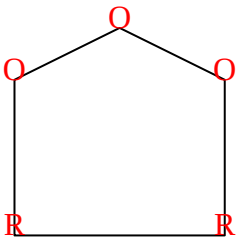

8)

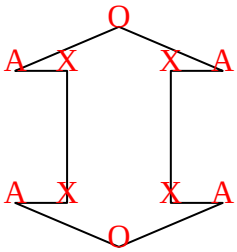

9)

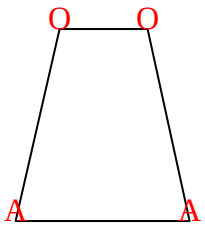

10)

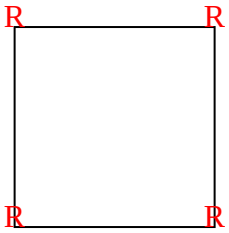

11)

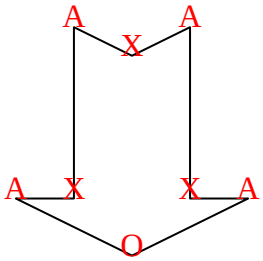

Answers

Ex.	4	0	0	3
1.	0	0	8	4
2.	2	3	0	1
3.	2	2	0	0
4.	2	1	1	1
5.	2	1	4	4
6.	5	0	0	5
7.	0	3	2	0
8.	4	2	0	4
9.	2	2	0	0
10.	0	0	4	0
11.	4	1	0	3

1-10	91	82	73	64	55	45	36	27	18	9
11	0									

Finding Angles within Shapes

Name:

Count the number of Acute, Obtuse, Right and Reflex angles in each shape.

Ex)

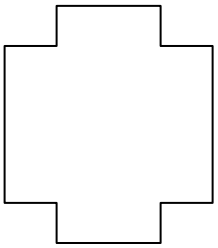

1)

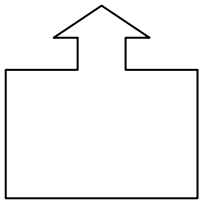

2)

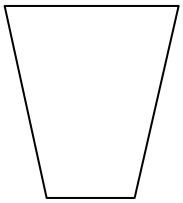

3)

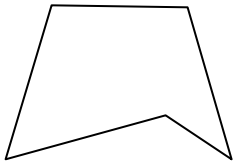

4)

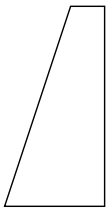

5)

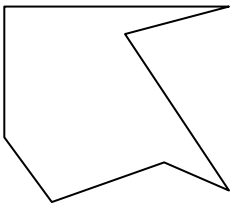

6)

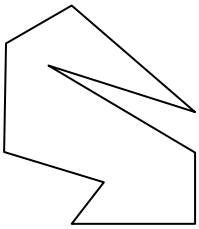

7)



8)



9)

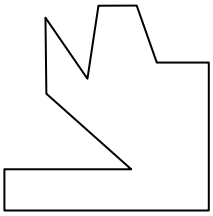

10)

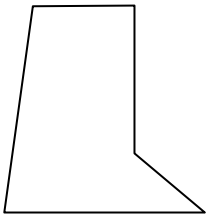

11)

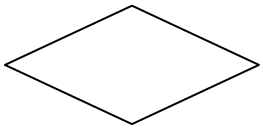

Answers

Ex.	0	0	8	4
1.				
2.				
3.				
4.				
5.				
6.				
7.				
8.				
9.				
10.				
11.				

1-10	91	82	73	64	55	45	36	27	18	9
11	0									

Finding Angles within Shapes

Name: **Answer Key**

Count the number of Acute, Obtuse, Right and Reflex angles in each shape.

Ex)

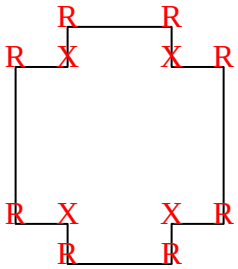

1)

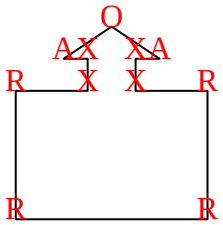

2)

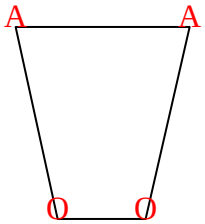

3)

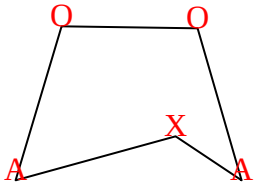

4)

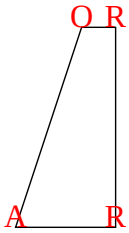

5)

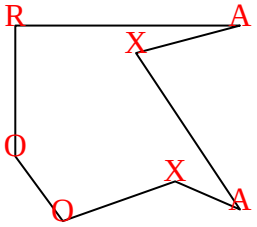

6)

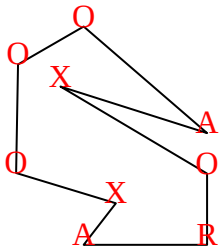

7)

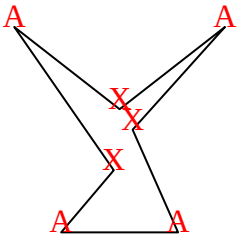

8)



9)

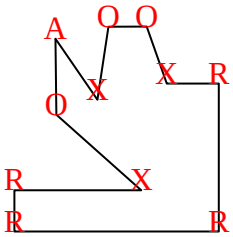

10)

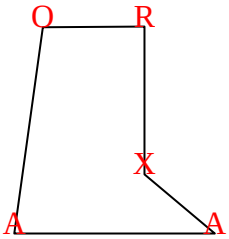

11)

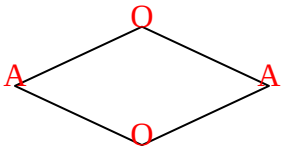

Answers

Ex.	0	0	8	4
1.	2	1	4	4
2.	2	2	0	0
3.	2	2	0	1
4.	1	1	2	0
5.	2	2	1	2
6.	2	4	1	2
7.	4	0	0	3
8.	0	0	4	0
9.	1	3	4	3
10.	2	1	1	1
11.	2	2	0	0

1-10	91	82	73	64	55	45	36	27	18	9
11	0									

Finding Angles within Shapes

Name:

Count the number of Acute, Obtuse, Right and Reflex angles in each shape.

Ex)

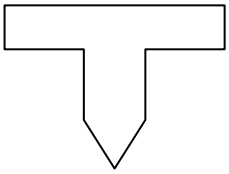

1)

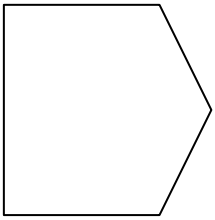

2)

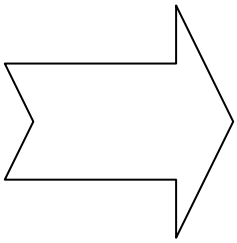

3)

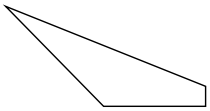

4)

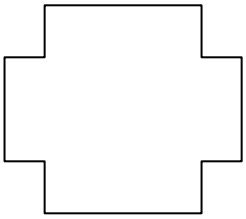

5)

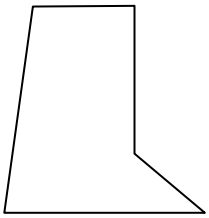

6)



7)



8)

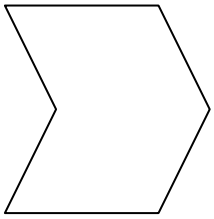

9)

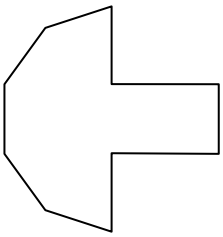

10)

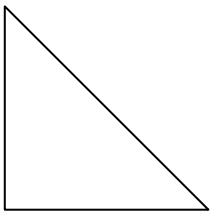

11)

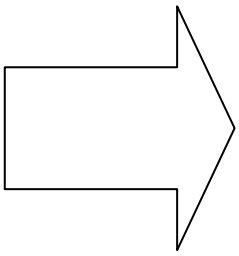

Answers

Ex.	1	2	4	2
1.				
2.				
3.				
4.				
5.				
6.				
7.				
8.				
9.				
10.				
11.				

1-10	91	82	73	64	55	45	36	27	18	9
11	0									

Finding Angles within Shapes

Name: **Answer Key**

Count the number of Acute, Obtuse, Right and Reflex angles in each shape.

Ex)

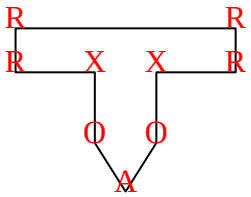

1)

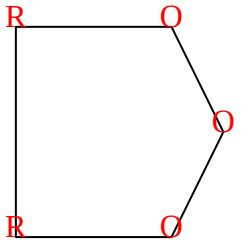

2)

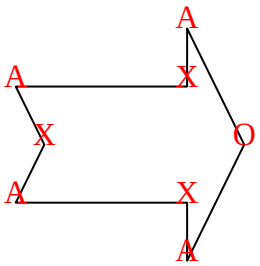

3)

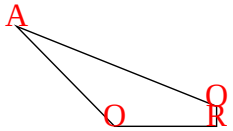

4)

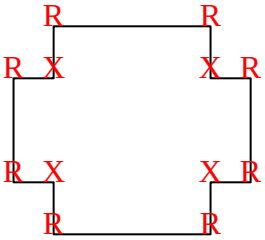

5)

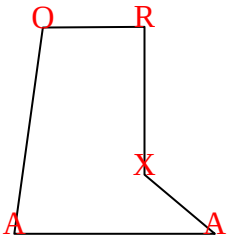

6)

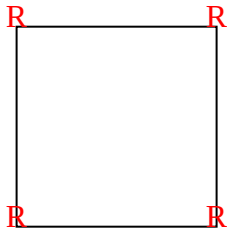

7)



8)

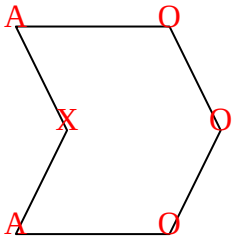

9)

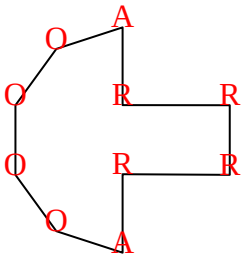

10)

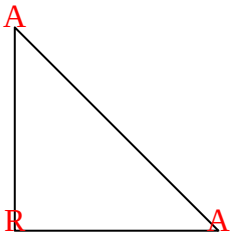

11)

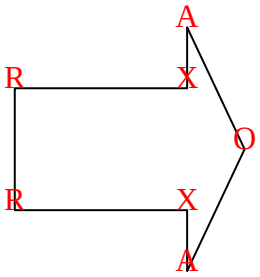

Answers

Ex.	1	2	4	2
1.	0	3	2	0
2.	4	1	0	3
3.	1	2	1	0
4.	0	0	8	4
5.	2	1	1	1
6.	0	0	4	0
7.	0	0	4	0
8.	2	3	0	1
9.	2	4	4	0
10.	2	0	1	0
11.	2	1	2	2

1-10	91	82	73	64	55	45	36	27	18	9
11	0									

Finding Angles within Shapes

Name:

Count the number of Acute, Obtuse, Right and Reflex angles in each shape.

Ex)



1)

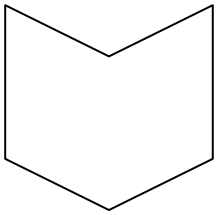

2)

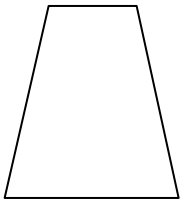

3)



4)

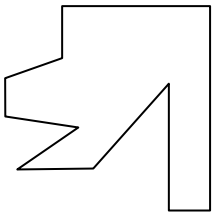

5)

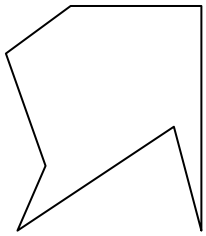

6)

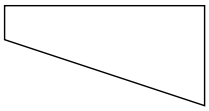

7)

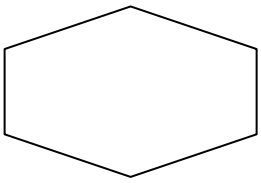

8)

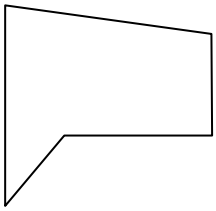

9)

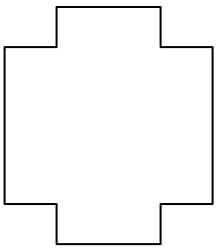

10)

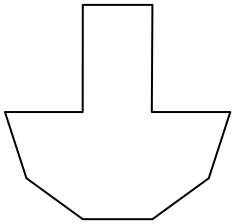

11)

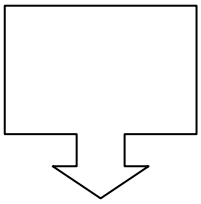

Answers

Ex.	2	2	1	1
1.				
2.				
3.				
4.				
5.				
6.				
7.				
8.				
9.				
10.				
11.				

1-10	91	82	73	64	55	45	36	27	18	9
11	0									

Finding Angles within Shapes

Name: **Answer Key**

Count the number of Acute, Obtuse, Right and Reflex angles in each shape.

Ex)

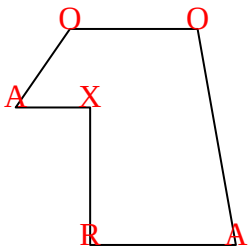

1)

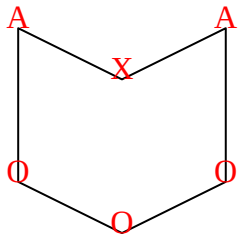

2)

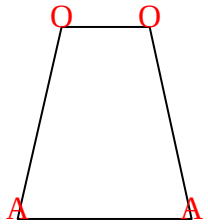

3)

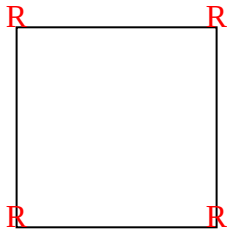

4)

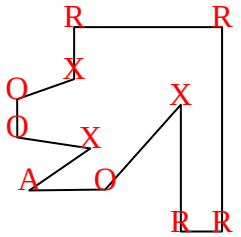

5)

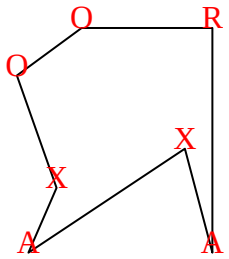

6)

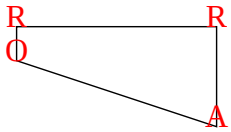

7)

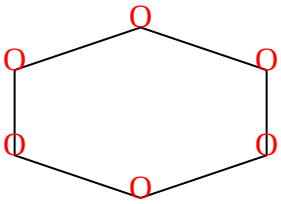

8)

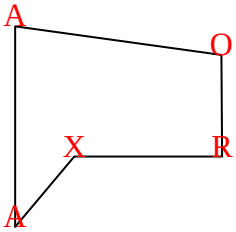

9)

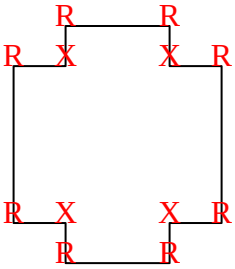

10)

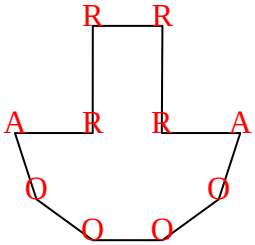

11)

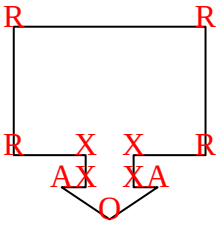

Answers

Ex.	2	2	1	1
1.	2	3	0	1
2.	2	2	0	0
3.	0	0	4	0
4.	1	3	4	3
5.	2	2	1	2
6.	1	1	2	0
7.	0	0	6	0
8.	2	1	1	1
9.	0	0	8	4
10.	2	4	4	0
11.	2	1	4	4

1-10	91	82	73	64	55	45	36	27	18	9
11	0									

Finding Angles within Shapes Name:

Count the number of Acute, Obtuse, Right and Reflex angles in each shape.

Ex)



1)

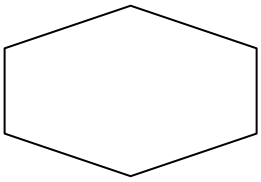

2)

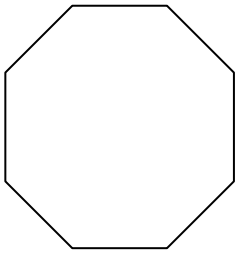

3)

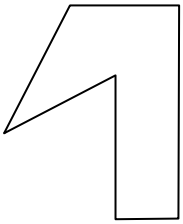

4)

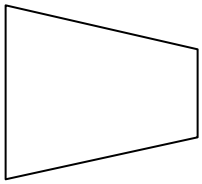

5)



6)



7)

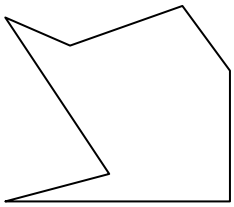

8)

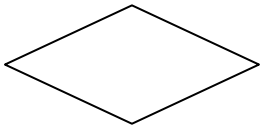

9)

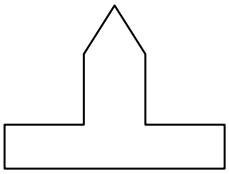

10)

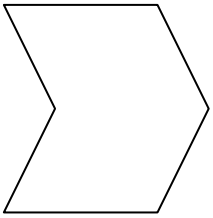

11)

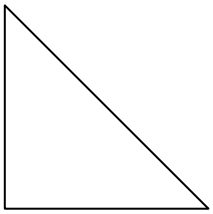

Answers

Ex.	4	0	0	3
1.				
2.				
3.				
4.				
5.				
6.				
7.				
8.				
9.				
10.				
11.				

1-10	91	82	73	64	55	45	36	27	18	9
11	0									

Finding Angles within Shapes

Name: **Answer Key**

Count the number of Acute, Obtuse, Right and Reflex angles in each shape.

Ex)

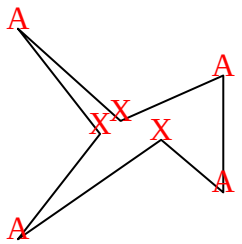

1)

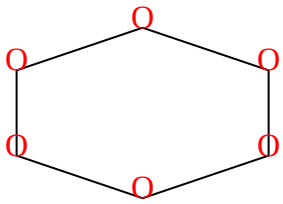

2)

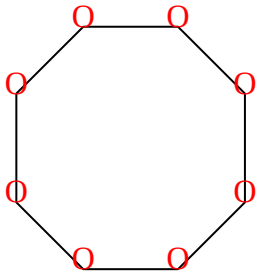

3)

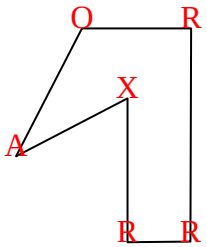

4)

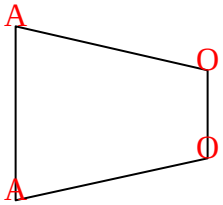

5)

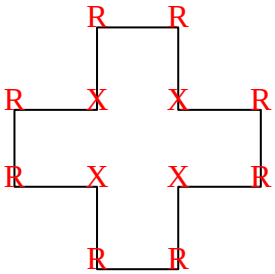

6)

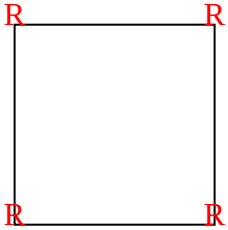

7)

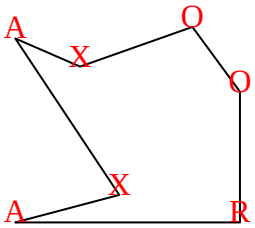

8)

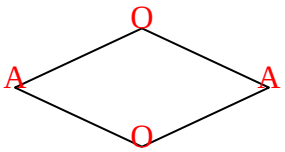

9)

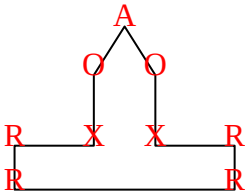

10)

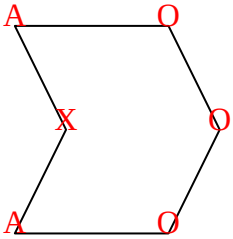

11)

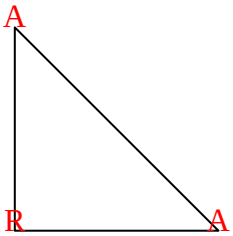

Answers

Ex.	4	0	0	3
1.	0	0	6	0
2.	0	8	0	0
3.	1	1	3	1
4.	2	2	0	0
5.	0	0	8	4
6.	0	0	4	0
7.	2	2	1	2
8.	2	2	0	0
9.	1	2	4	2
10.	2	3	0	1
11.	2	0	1	0

1-10	91	82	73	64	55	45	36	27	18	9
11	0									

Finding Angles within Shapes

Name:

Count the number of Acute, Obtuse, Right and Reflex angles in each shape.

Ex)

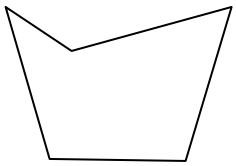

1)

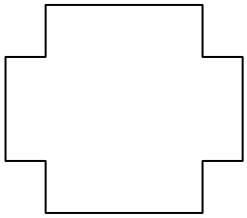

2)

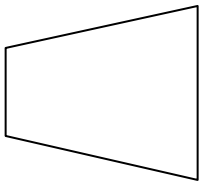

3)

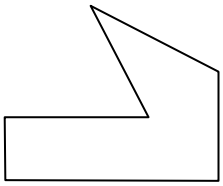

4)

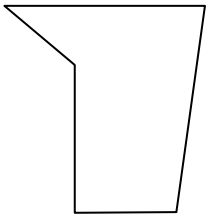

5)



6)

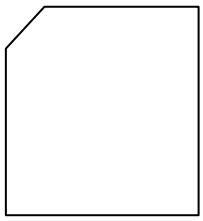

7)

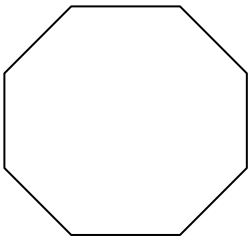

8)

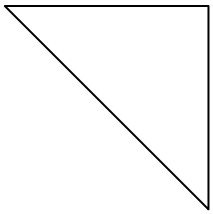

9)

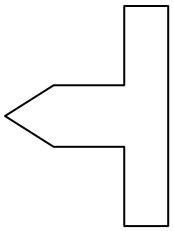

10)

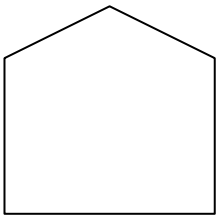

11)

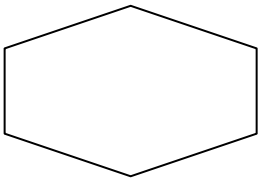

Answers

Ex.	2	2	0	1
1.				
2.				
3.				
4.				
5.				
6.				
7.				
8.				
9.				
10.				
11.				

1-10	91	82	73	64	55	45	36	27	18	9
11	0									

Finding Angles within Shapes

Name: **Answer Key**

Count the number of Acute, Obtuse, Right and Reflex angles in each shape.

Ex)

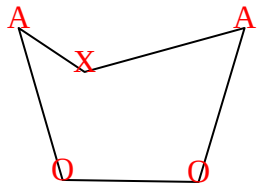

1)

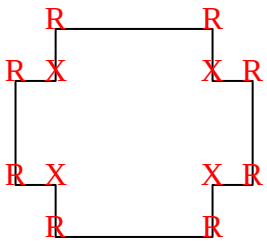

2)

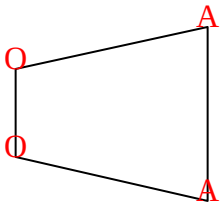

3)

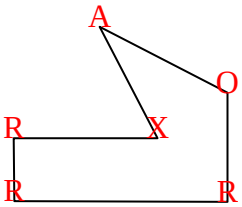

4)

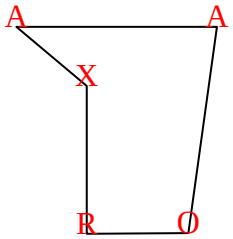

5)

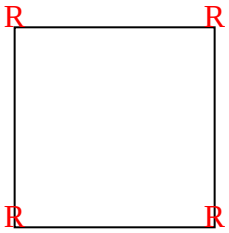

6)

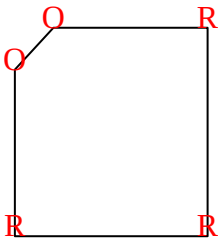

7)

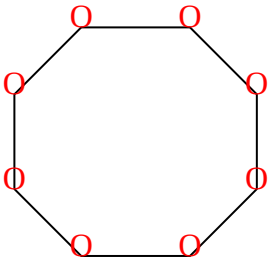

8)

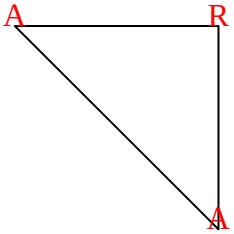

9)

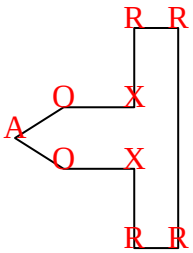

10)

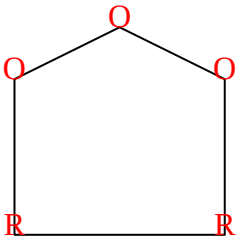

11)

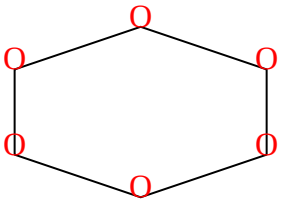

Answers

Ex.	2	2	0	1
1.	0	0	8	4
2.	2	2	0	0
3.	1	1	3	1
4.	2	1	1	1
5.	0	0	4	0
6.	0	2	3	0
7.	0	8	0	0
8.	2	0	1	0
9.	1	2	4	2
10.	0	3	2	0
11.	0	0	6	0

1-10	91	82	73	64	55	45	36	27	18	9
11	0									