Completing and Matching Volume Equations

Name:

Match each problem with the equation that could represent it. Answer with the missing term and letter.

Ex)

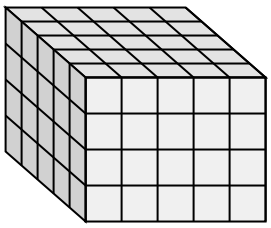

1)

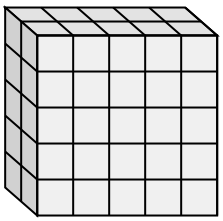

2)

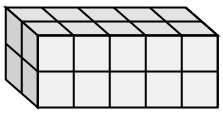

3)

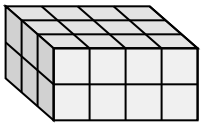

4)

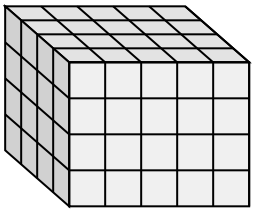

5)

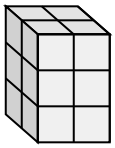

6)

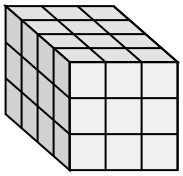

7)

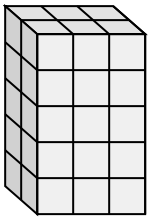

8)

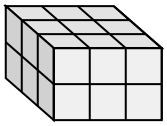

9)

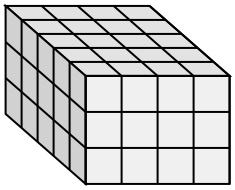

10)

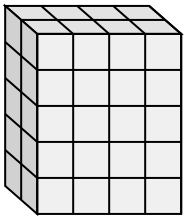

11)

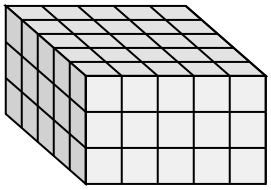

A. 2 × 3 × 5 = ___

B. 2 × 4 × 5 = ___

C. 5 × ___ × 4 = 100

D. 3 × 4 × ___ = 24

E. 2 × 5 × 5 = ___

F. 4 × 5 × ___ = 80

G. 2 × 2 × 3 = ___

H. ___ × 3 × 2 = 18

I. 4 × 3 × 3 = ___

J. 2 × ___ × 2 = 20

K. 5 × 4 × 3 = ___

L. 5 × ___ × 3 = 75

Answers

Ex. C , 5

1. _____
2. _____
3. _____
4. _____
5. _____
6. _____
7. _____
8. _____
9. _____
10. _____
11. _____

Completing and Matching Volume Equations Name: **Answer Key**

Match each problem with the equation that could represent it. Answer with the missing term and letter.

Ex) 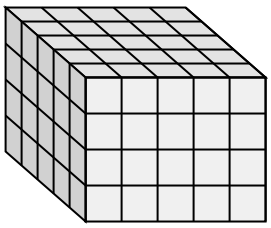

1) 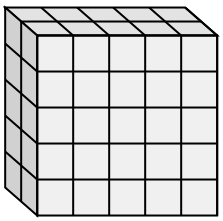

2) 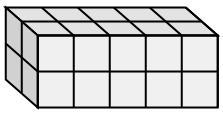

3) 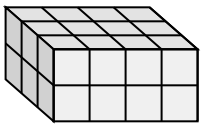

4) 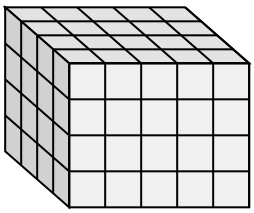

5) 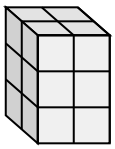

6) 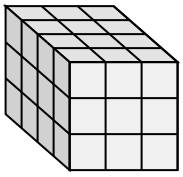

7) 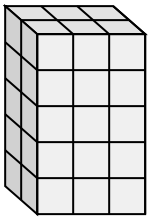

8) 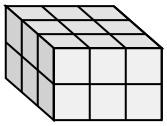

9) 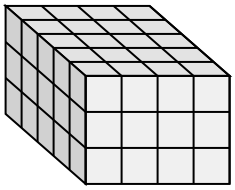

10) 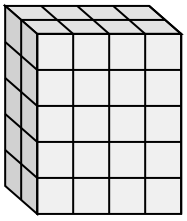

11) 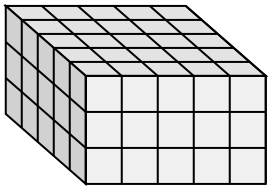

A. 2 × 3 × 5 = ___

B. 2 × 4 × 5 = ___

C. 5 × ___ × 4 = 100

D. 3 × 4 × ___ = 24

E. 2 × 5 × 5 = ___

F. 4 × 5 × ___ = 80

G. 2 × 2 × 3 = ___

H. ___ × 3 × 2 = 18

I. 4 × 3 × 3 = ___

J. 2 × ___ × 2 = 20

K. 5 × 4 × 3 = ___

L. 5 × ___ × 3 = 75

Answers

Ex. C , 5

1. E , 50
2. J , 5
3. D , 2
4. F , 4
5. G , 12
6. I , 36
7. A , 30
8. H , 3
9. K , 60
10. B , 40
11. L , 5

1-10	91	82	73	64	55	45	36	27	18	9
11	0									