Fraction, Decimal & Percent (Visual)

Name:

Determine the value written as a fraction , decimal & a percent.

Ex)

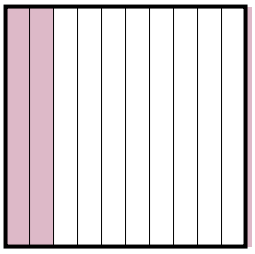

fraction $\frac{4}{10}$
decimal 0.4
percent 40

1)

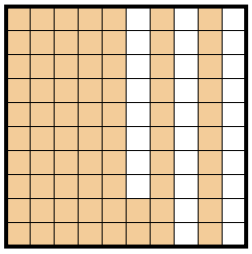

fraction
decimal
percent

2)

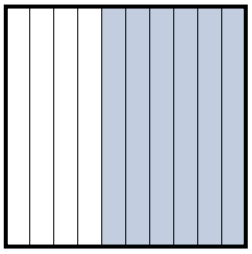

fraction
decimal
percent

3)

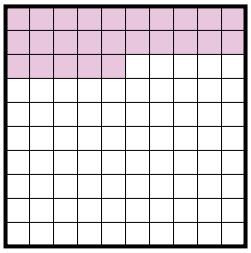

fraction
decimal
percent

4)

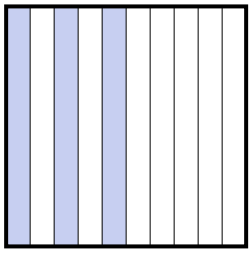

fraction
decimal
percent

5)

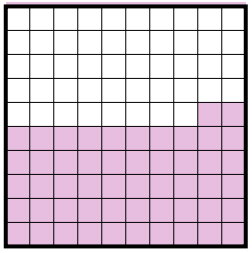

fraction
decimal
percent

6)

fraction
decimal
percent

7)

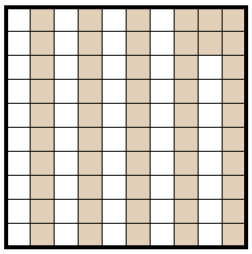

fraction
decimal
percent

8)

fraction
decimal
percent

9)

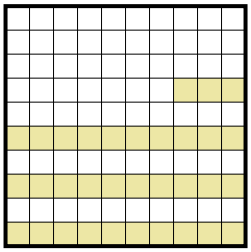

fraction
decimal
percent

10)

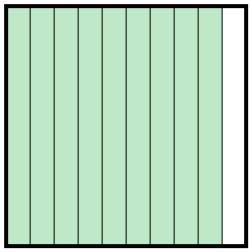

fraction
decimal
percent

11)

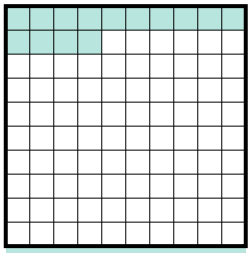

fraction
decimal
percent

Answers

Ex.	$\frac{4}{10}$	0.4	40%
1.			
2.			
3.			
4.			
5.			
6.			
7.			
8.			
9.			
10.			
11.			

Fraction, Decimal & Percent (Visual) Name: **Answer Key**

Determine the value written as a fraction , decimal & a percent.

Ex)

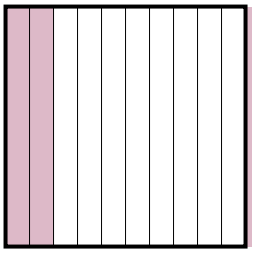

fraction $\frac{4}{10}$
decimal 0.4
percent 40

1)

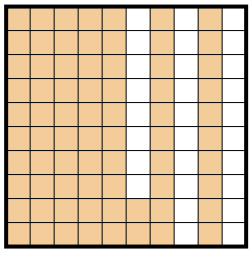

fraction $\frac{72}{100}$
decimal 0.72
percent 72

2)

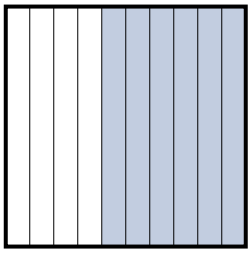

fraction $\frac{6}{10}$
decimal 0.6
percent 60

3)

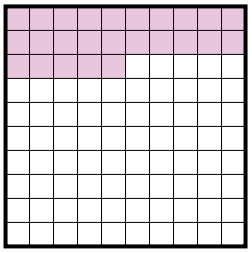

fraction $\frac{25}{100}$
decimal 0.25
percent 25

4)

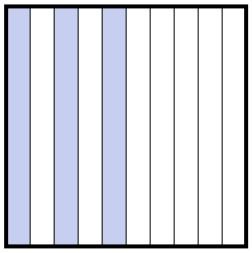

fraction $\frac{3}{10}$
decimal 0.3
percent 30

5)

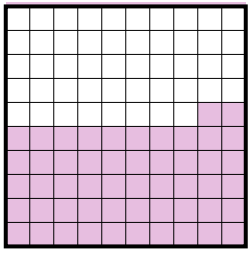

fraction $\frac{92}{100}$
decimal 0.92
percent 92

6)

fraction $\frac{7}{10}$
decimal 0.7
percent 70

7)

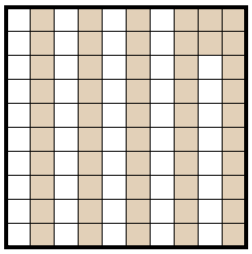

fraction $\frac{52}{100}$
decimal 0.52
percent 52

8)

fraction $\frac{5}{10}$
decimal 0.5
percent 50

9)

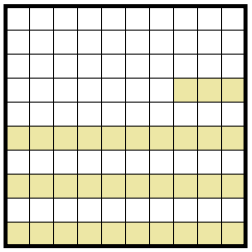

fraction $\frac{33}{100}$
decimal 0.33
percent 33

10)

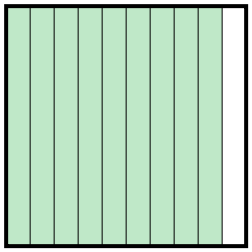

fraction $\frac{9}{10}$
decimal 0.9
percent 90

11)

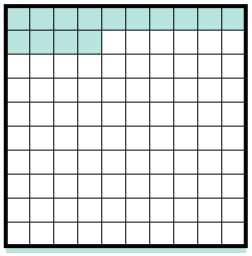

fraction $\frac{24}{100}$
decimal 0.24
percent 24

Answers

Ex.	$\frac{4}{10}$	0.4	40%
1.	$\frac{72}{100}$	0.72	72%
2.	$\frac{6}{10}$	0.6	60%
3.	$\frac{25}{100}$	0.25	25%
4.	$\frac{3}{10}$	0.3	30%
5.	$\frac{92}{100}$	0.92	92%
6.	$\frac{7}{10}$	0.7	70%
7.	$\frac{52}{100}$	0.52	52%
8.	$\frac{5}{10}$	0.5	50%
9.	$\frac{33}{100}$	0.33	33%
10.	$\frac{9}{10}$	0.9	90%
11.	$\frac{24}{100}$	0.24	24%