Fraction, Decimal & Percent (Visual)

Name:

Determine the value written as a fraction , decimal & a percent.

Ex)

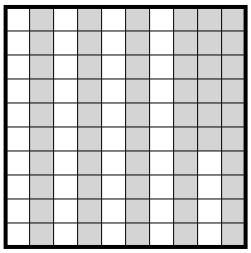

fraction $^{56}/_{100}$
decimal 0.56
percent 56

1)

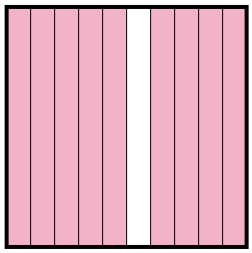

fraction _____
decimal _____
percent _____

2)

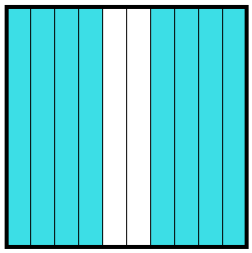

fraction _____
decimal _____
percent _____

3)

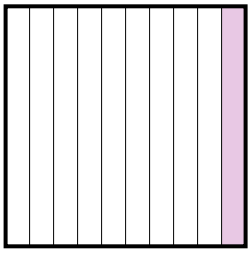

fraction _____
decimal _____
percent _____

4)

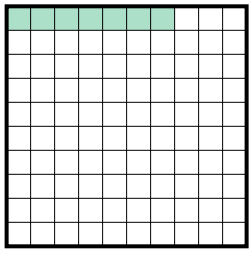

fraction _____
decimal _____
percent _____

5)

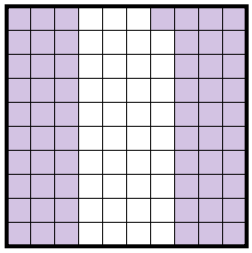

fraction _____
decimal _____
percent _____

6)



fraction _____
decimal _____
percent _____

7)

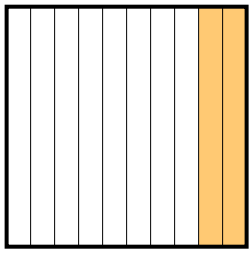

fraction _____
decimal _____
percent _____

8)



fraction _____
decimal _____
percent _____

9)

fraction _____
decimal _____
percent _____

10)

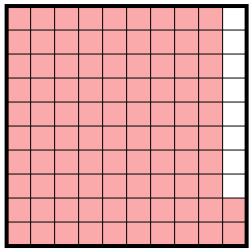

fraction _____
decimal _____
percent _____

11)

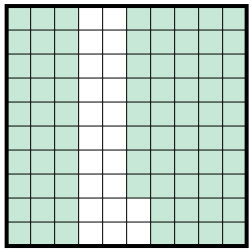

fraction _____
decimal _____
percent _____

Answers

Ex.	$^{56}/_{100}$	0.56	56%
1.			
2.			
3.			
4.			
5.			
6.			
7.			
8.			
9.			
10.			
11.			

1-10	91	82	73	64	55	45	36	27	18	9
11	0									

Fraction, Decimal & Percent (Visual)

Name: **Answer Key**

Determine the value written as a fraction , decimal & a percent.

Ex)

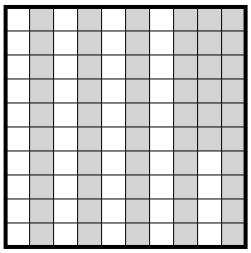

fraction $56/100$
decimal 0.56
percent 56

1)

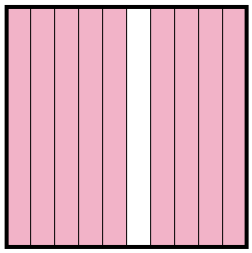

fraction $9/10$
decimal 0.9
percent 90

2)

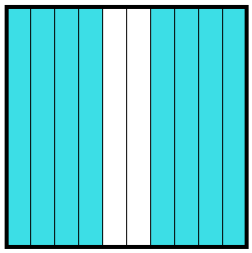

fraction $8/10$
decimal 0.8
percent 80

3)

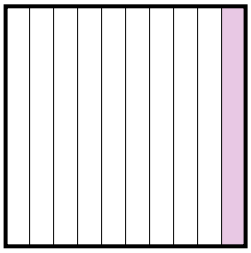

fraction $1/10$
decimal 0.1
percent 10

4)

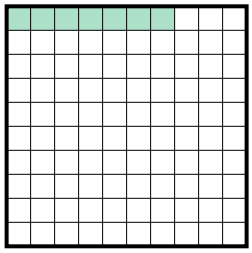

fraction $7/100$
decimal 0.07
percent 7

5)

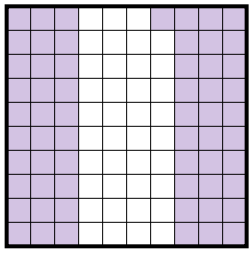

fraction $61/100$
decimal 0.61
percent 61

6)



fraction $5/10$
decimal 0.5
percent 50

7)

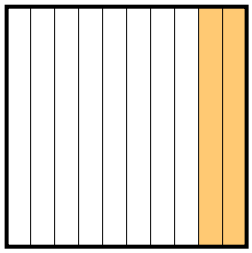

fraction $2/10$
decimal 0.2
percent 20

8)



fraction $3/10$
decimal 0.3
percent 30

9)

fraction $6/10$
decimal 0.6
percent 60

10)

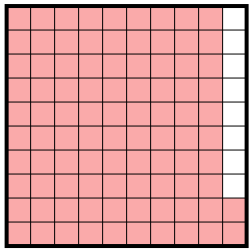

fraction $92/100$
decimal 0.92
percent 92

11)

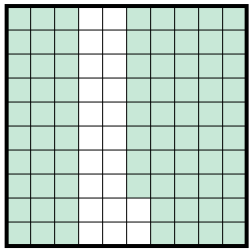

fraction $78/100$
decimal 0.78
percent 78

Answers

Ex.	$56/100$	0.56	56%
1.	$9/10$	0.9	90%
2.	$8/10$	0.8	80%
3.	$1/10$	0.1	10%
4.	$7/100$	0.07	7%
5.	$61/100$	0.61	61%
6.	$5/10$	0.5	50%
7.	$2/10$	0.2	20%
8.	$3/10$	0.3	30%
9.	$6/10$	0.6	60%
10.	$92/100$	0.92	92%
11.	$78/100$	0.78	78%

1-10	91	82	73	64	55	45	36	27	18	9
11	0									

Fraction, Decimal & Percent (Visual)

Name:

Determine the value written as a fraction , decimal & a percent.

Ex)

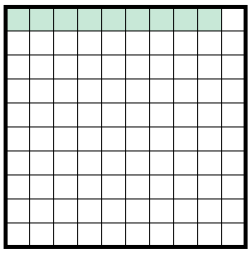

fraction $^{9}/_{100}$
decimal 0.09
percent 9

1)

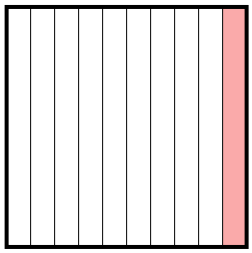

fraction _____
decimal _____
percent _____

2)

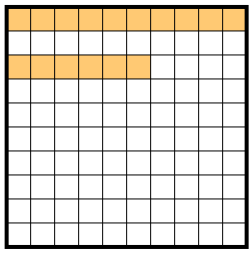

fraction _____
decimal _____
percent _____

3)

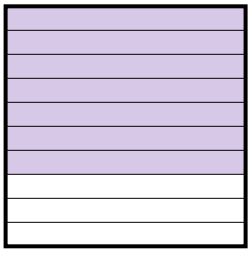

fraction _____
decimal _____
percent _____

4)

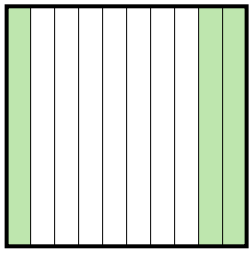

fraction _____
decimal _____
percent _____

5)



fraction _____
decimal _____
percent _____

6)

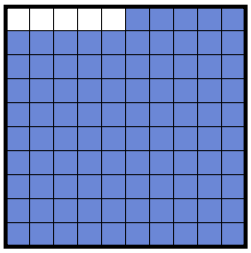

fraction _____
decimal _____
percent _____

7)

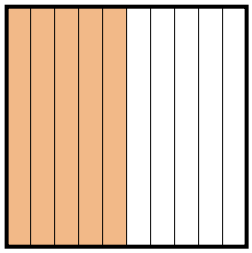

fraction _____
decimal _____
percent _____

8)

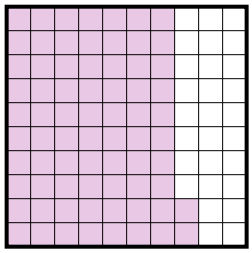

fraction _____
decimal _____
percent _____

9)

fraction _____
decimal _____
percent _____

10)



fraction _____
decimal _____
percent _____

11)



fraction _____
decimal _____
percent _____

Answers

Ex.	$^{9}/_{100}$	0.09	9%
1.			
2.			
3.			
4.			
5.			
6.			
7.			
8.			
9.			
10.			
11.			

1-10	91	82	73	64	55	45	36	27	18	9
11	0									

Fraction, Decimal & Percent (Visual) Name: **Answer Key**

Determine the value written as a fraction , decimal & a percent.

Ex)

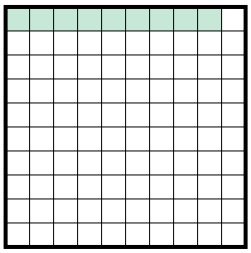

fraction $^{9}/_{100}$
decimal 0.09
percent 9

1)

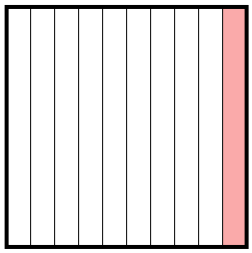

fraction $^{1}/_{10}$
decimal 0.1
percent 10

2)

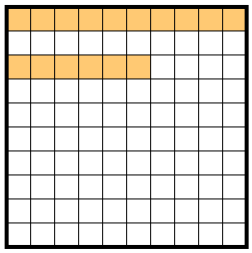

fraction $^{16}/_{100}$
decimal 0.16
percent 16

3)

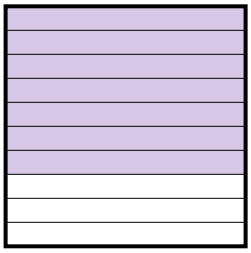

fraction $^{7}/_{10}$
decimal 0.7
percent 70

4)

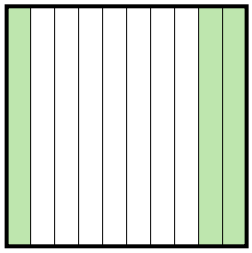

fraction $^{3}/_{10}$
decimal 0.3
percent 30

5)



fraction $^{14}/_{100}$
decimal 0.14
percent 14

6)

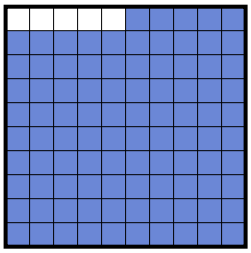

fraction $^{95}/_{100}$
decimal 0.95
percent 95

7)

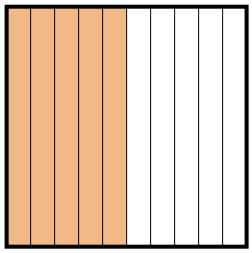

fraction $^{5}/_{10}$
decimal 0.5
percent 50

8)

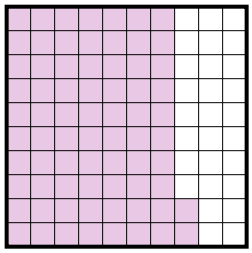

fraction $^{72}/_{100}$
decimal 0.72
percent 72

9)

fraction $^{4}/_{10}$
decimal 0.4
percent 40

10)



fraction $^{2}/_{10}$
decimal 0.2
percent 20

11)



fraction $^{6}/_{10}$
decimal 0.6
percent 60

Answers

Ex.	$^{9}/_{100}$	0.09	9%
1.	$^{1}/_{10}$	0.1	10%
2.	$^{16}/_{100}$	0.16	16%
3.	$^{7}/_{10}$	0.7	70%
4.	$^{3}/_{10}$	0.3	30%
5.	$^{14}/_{100}$	0.14	14%
6.	$^{95}/_{100}$	0.95	95%
7.	$^{5}/_{10}$	0.5	50%
8.	$^{72}/_{100}$	0.72	72%
9.	$^{4}/_{10}$	0.4	40%
10.	$^{2}/_{10}$	0.2	20%
11.	$^{6}/_{10}$	0.6	60%

1-10	91	82	73	64	55	45	36	27	18	9
11	0									

Fraction, Decimal & Percent (Visual)

Name:

Determine the value written as a fraction , decimal & a percent.

Ex)

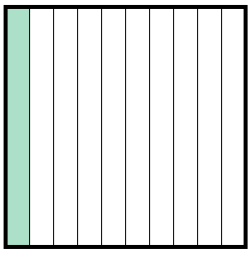

fraction $\frac{1}{10}$
decimal 0.1
percent 10

1)

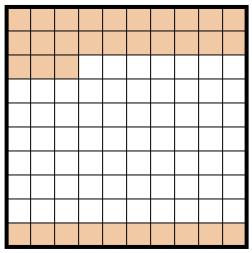

fraction _____
decimal _____
percent _____

2)

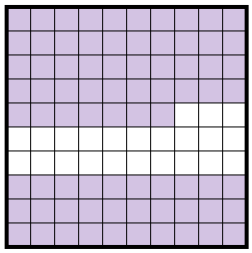

fraction _____
decimal _____
percent _____

3)

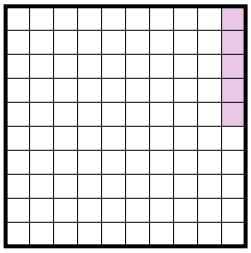

fraction _____
decimal _____
percent _____

4)

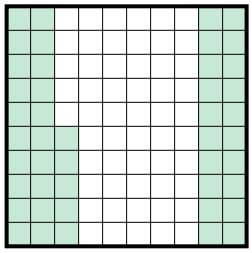

fraction _____
decimal _____
percent _____

5)

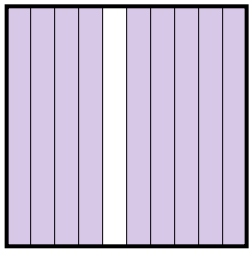

fraction _____
decimal _____
percent _____

6)

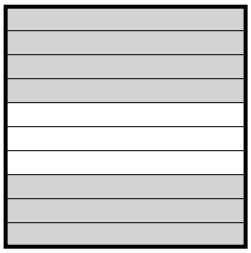

fraction _____
decimal _____
percent _____

7)



fraction _____
decimal _____
percent _____

8)



fraction _____
decimal _____
percent _____

9)

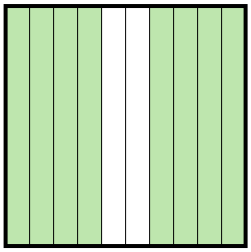

fraction _____
decimal _____
percent _____

10)

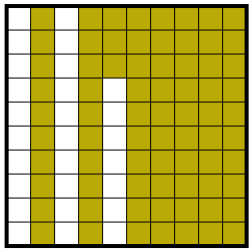

fraction _____
decimal _____
percent _____

11)

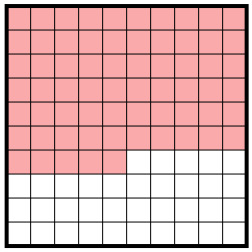

fraction _____
decimal _____
percent _____

Answers

Ex.	$\frac{1}{10}$	0.1	10%
1.			
2.			
3.			
4.			
5.			
6.			
7.			
8.			
9.			
10.			
11.			

1-10	91	82	73	64	55	45	36	27	18	9
11	0									

Fraction, Decimal & Percent (Visual) Name: **Answer Key**

Determine the value written as a fraction , decimal & a percent.

Ex)

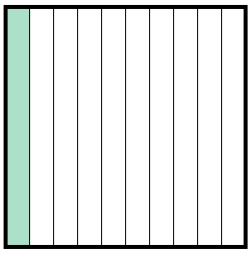

fraction $\frac{1}{10}$
decimal 0.1
percent 10

1)

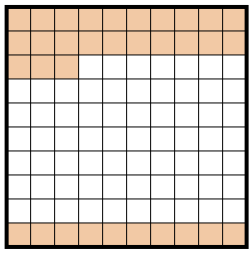

fraction $\frac{33}{100}$
decimal 0.33
percent 33

2)

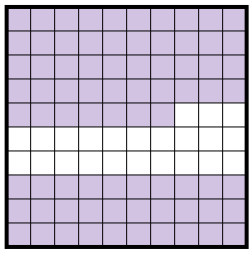

fraction $\frac{77}{100}$
decimal 0.77
percent 77

3)

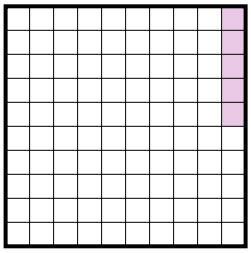

fraction $\frac{5}{100}$
decimal 0.05
percent 5

4)

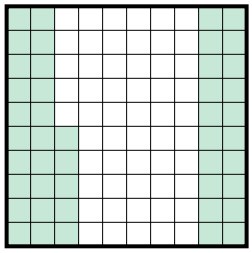

fraction $\frac{45}{100}$
decimal 0.45
percent 45

5)

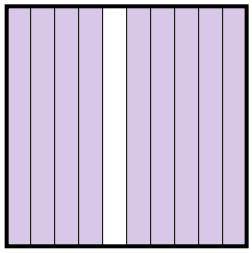

fraction $\frac{9}{10}$
decimal 0.9
percent 90

6)

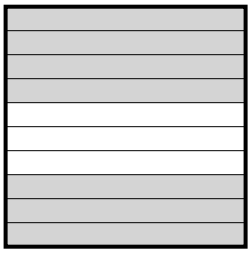

fraction $\frac{7}{10}$
decimal 0.7
percent 70

7)



fraction $\frac{3}{10}$
decimal 0.3
percent 30

8)



fraction $\frac{2}{10}$
decimal 0.2
percent 20

9)

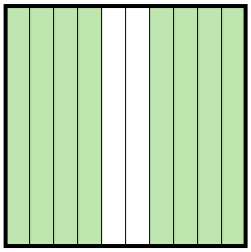

fraction $\frac{8}{10}$
decimal 0.8
percent 80

10)

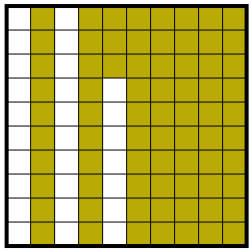

fraction $\frac{73}{100}$
decimal 0.73
percent 73

11)

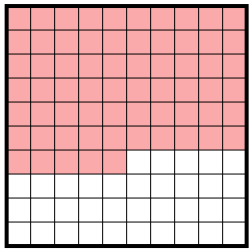

fraction $\frac{65}{100}$
decimal 0.65
percent 65

Answers

Ex.	$\frac{1}{10}$	0.1	10%
1.	$\frac{33}{100}$	0.33	33%
2.	$\frac{77}{100}$	0.77	77%
3.	$\frac{5}{100}$	0.05	5%
4.	$\frac{45}{100}$	0.45	45%
5.	$\frac{9}{10}$	0.9	90%
6.	$\frac{7}{10}$	0.7	70%
7.	$\frac{3}{10}$	0.3	30%
8.	$\frac{2}{10}$	0.2	20%
9.	$\frac{8}{10}$	0.8	80%
10.	$\frac{73}{100}$	0.73	73%
11.	$\frac{65}{100}$	0.65	65%

1-10	91	82	73	64	55	45	36	27	18	9
11	0									

Fraction, Decimal & Percent (Visual)

Name:

Determine the value written as a fraction , decimal & a percent.

Ex)

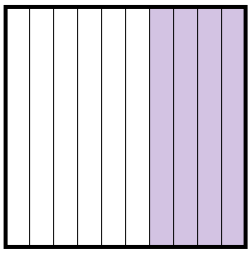

fraction $^{4}/_{10}$
decimal 0.4
percent 40

1)

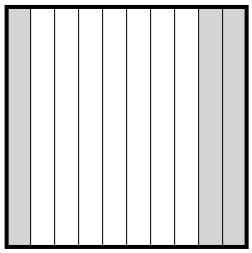

fraction _____
decimal _____
percent _____

2)

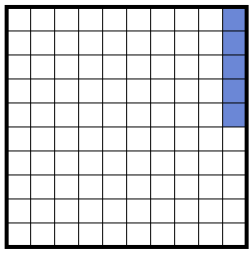

fraction _____
decimal _____
percent _____

3)

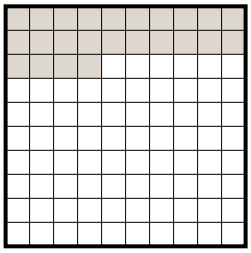

fraction _____
decimal _____
percent _____

4)

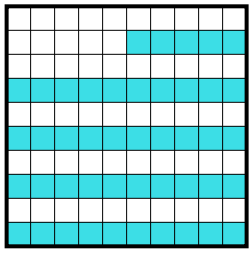

fraction _____
decimal _____
percent _____

5)

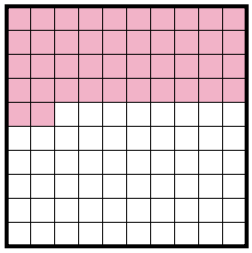

fraction _____
decimal _____
percent _____

6)



fraction _____
decimal _____
percent _____

7)



fraction _____
decimal _____
percent _____

8)

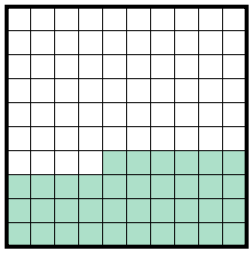

fraction _____
decimal _____
percent _____

9)

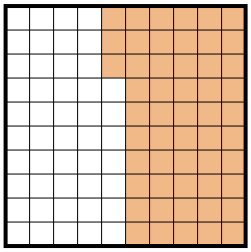

fraction _____
decimal _____
percent _____

10)

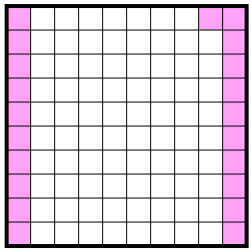

fraction _____
decimal _____
percent _____

11)



fraction _____
decimal _____
percent _____

Answers

Ex.	$^{4}/_{10}$	0.4	40%
1.			
2.			
3.			
4.			
5.			
6.			
7.			
8.			
9.			
10.			
11.			

1-10	91	82	73	64	55	45	36	27	18	9
11	0									

Fraction, Decimal & Percent (Visual) Name: **Answer Key**

Determine the value written as a fraction , decimal & a percent.

Ex)

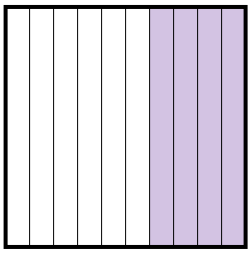

fraction $\frac{4}{10}$
decimal 0.4
percent 40

1)

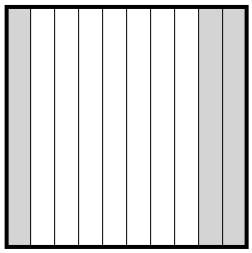

fraction $\frac{3}{10}$
decimal 0.3
percent 30

2)

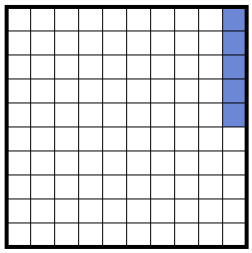

fraction $\frac{5}{100}$
decimal 0.05
percent 5

3)

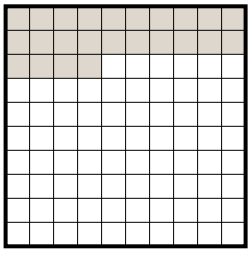

fraction $\frac{24}{100}$
decimal 0.24
percent 24

4)

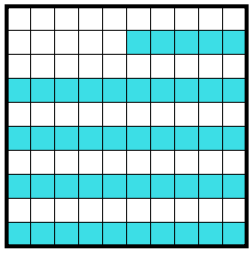

fraction $\frac{45}{100}$
decimal 0.45
percent 45

5)

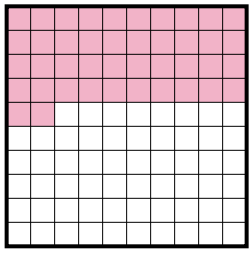

fraction $\frac{42}{100}$
decimal 0.42
percent 42

6)



fraction $\frac{2}{10}$
decimal 0.2
percent 20

7)



fraction $\frac{1}{10}$
decimal 0.1
percent 10

8)

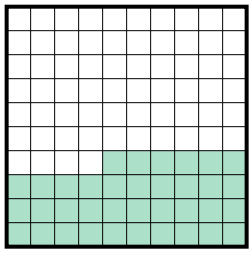

fraction $\frac{36}{100}$
decimal 0.36
percent 36

9)

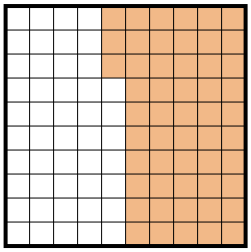

fraction $\frac{53}{100}$
decimal 0.53
percent 53

10)

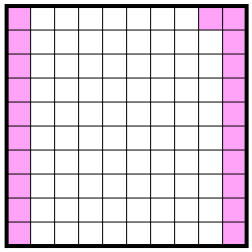

fraction $\frac{21}{100}$
decimal 0.21
percent 21

11)



fraction $\frac{8}{10}$
decimal 0.8
percent 80

Answers

Ex.	$\frac{4}{10}$	0.4	40%
1.	$\frac{3}{10}$	0.3	30%
2.	$\frac{5}{100}$	0.05	5%
3.	$\frac{24}{100}$	0.24	24%
4.	$\frac{45}{100}$	0.45	45%
5.	$\frac{42}{100}$	0.42	42%
6.	$\frac{2}{10}$	0.2	20%
7.	$\frac{1}{10}$	0.1	10%
8.	$\frac{36}{100}$	0.36	36%
9.	$\frac{53}{100}$	0.53	53%
10.	$\frac{21}{100}$	0.21	21%
11.	$\frac{8}{10}$	0.8	80%

1-10	91	82	73	64	55	45	36	27	18	9
11	0									

Fraction, Decimal & Percent (Visual)

Name:

Determine the value written as a fraction , decimal & a percent.

Ex)

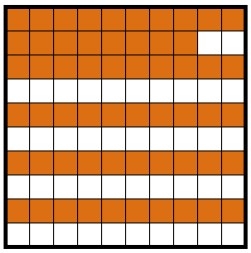

fraction $^{58}/_{100}$
decimal 0.58
percent 58

1)

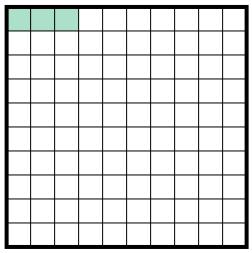

fraction _____
decimal _____
percent _____

2)

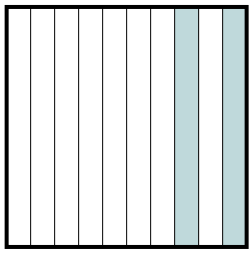

fraction _____
decimal _____
percent _____

3)



fraction _____
decimal _____
percent _____

4)

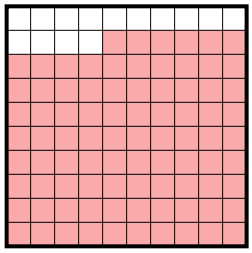

fraction _____
decimal _____
percent _____

5)

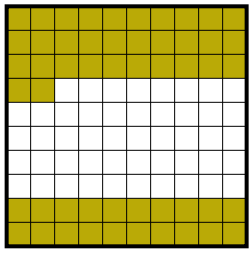

fraction _____
decimal _____
percent _____

6)

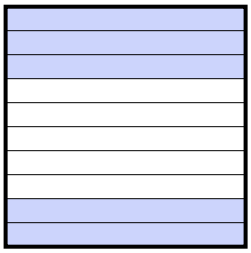

fraction _____
decimal _____
percent _____

7)

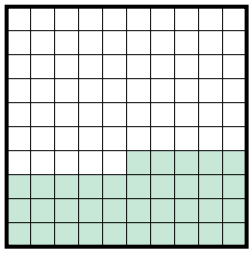

fraction _____
decimal _____
percent _____

8)

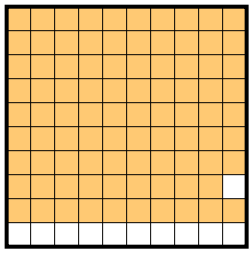

fraction _____
decimal _____
percent _____

9)

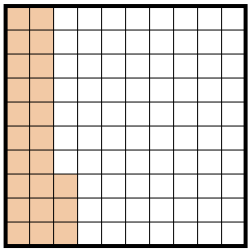

fraction _____
decimal _____
percent _____

10)

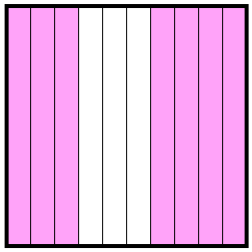

fraction _____
decimal _____
percent _____

11)

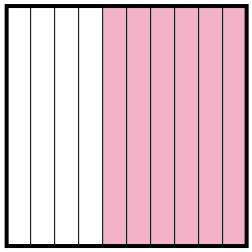

fraction _____
decimal _____
percent _____

Answers

Ex.	$^{58}/_{100}$	0.58	58%
1.			
2.			
3.			
4.			
5.			
6.			
7.			
8.			
9.			
10.			
11.			

1-10	91	82	73	64	55	45	36	27	18	9
11	0									

Fraction, Decimal & Percent (Visual) Name: **Answer Key**

Determine the value written as a fraction , decimal & a percent.

Ex)

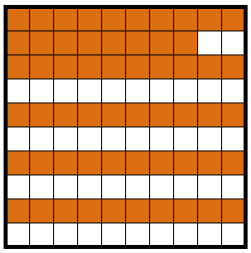

fraction $^{58}/_{100}$
decimal 0.58
percent 58

1)

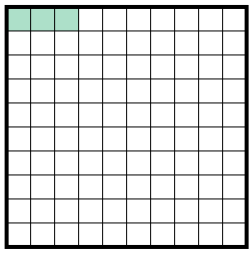

fraction $^{3}/_{100}$
decimal 0.03
percent 3

2)

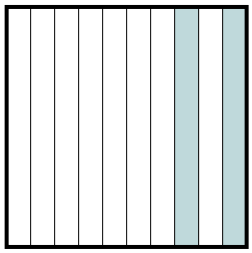

fraction $^{2}/_{10}$
decimal 0.2
percent 20

3)



fraction $^{4}/_{10}$
decimal 0.4
percent 40

4)

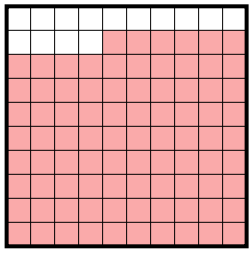

fraction $^{86}/_{100}$
decimal 0.86
percent 86

5)

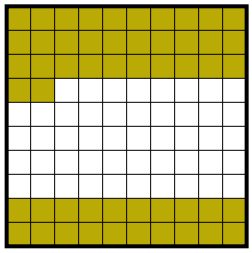

fraction $^{52}/_{100}$
decimal 0.52
percent 52

6)

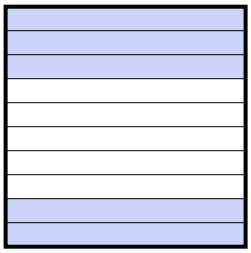

fraction $^{5}/_{10}$
decimal 0.5
percent 50

7)

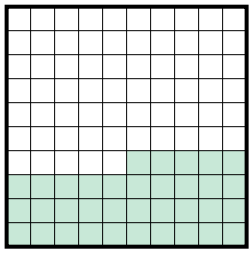

fraction $^{35}/_{100}$
decimal 0.35
percent 35

8)

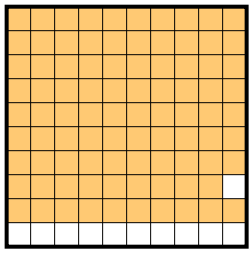

fraction $^{89}/_{100}$
decimal 0.89
percent 89

9)

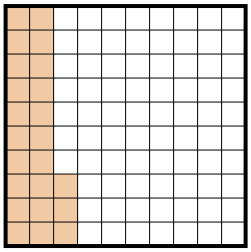

fraction $^{23}/_{100}$
decimal 0.23
percent 23

10)

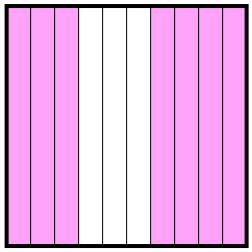

fraction $^{7}/_{10}$
decimal 0.7
percent 70

11)

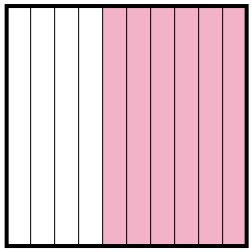

fraction $^{6}/_{10}$
decimal 0.6
percent 60

Answers

Ex.	$^{58}/_{100}$	0.58	58%
1.	$^{3}/_{100}$	0.03	3%
2.	$^{2}/_{10}$	0.2	20%
3.	$^{4}/_{10}$	0.4	40%
4.	$^{86}/_{100}$	0.86	86%
5.	$^{52}/_{100}$	0.52	52%
6.	$^{5}/_{10}$	0.5	50%
7.	$^{35}/_{100}$	0.35	35%
8.	$^{89}/_{100}$	0.89	89%
9.	$^{23}/_{100}$	0.23	23%
10.	$^{7}/_{10}$	0.7	70%
11.	$^{6}/_{10}$	0.6	60%

1-10	91	82	73	64	55	45	36	27	18	9
11	0									

Fraction, Decimal & Percent (Visual) Name:

Determine the value written as a fraction , decimal & a percent.

Ex)

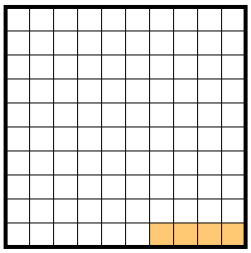

fraction $^{4}/_{100}$
decimal 0.04
percent 4

1)

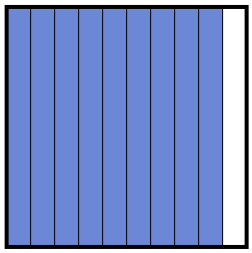

fraction _____
decimal _____
percent _____

2)



fraction _____
decimal _____
percent _____

3)



fraction _____
decimal _____
percent _____

4)

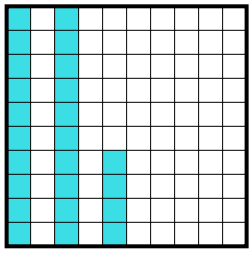

fraction _____
decimal _____
percent _____

5)

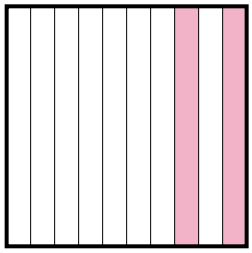

fraction _____
decimal _____
percent _____

6)

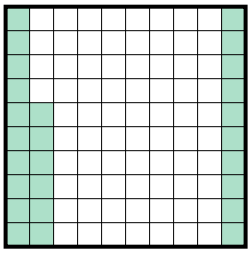

fraction _____
decimal _____
percent _____

7)

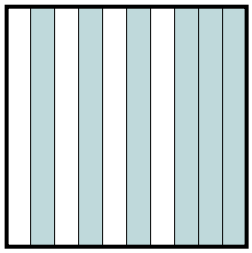

fraction _____
decimal _____
percent _____

8)

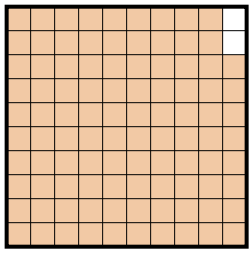

fraction _____
decimal _____
percent _____

9)

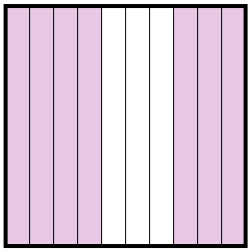

fraction _____
decimal _____
percent _____

10)

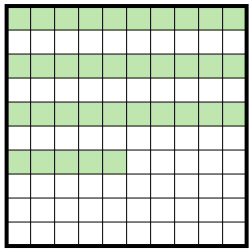

fraction _____
decimal _____
percent _____

11)

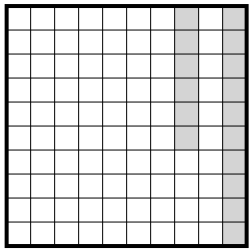

fraction _____
decimal _____
percent _____

Answers

Ex.	$^{4}/_{100}$	0.04	4%
1.			
2.			
3.			
4.			
5.			
6.			
7.			
8.			
9.			
10.			
11.			

1-10	91	82	73	64	55	45	36	27	18	9
11	0									

Fraction, Decimal & Percent (Visual) Name: **Answer Key**

Determine the value written as a fraction , decimal & a percent.

Ex)

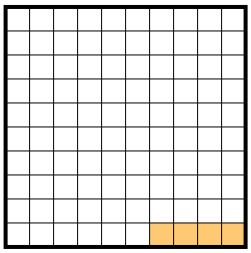

fraction $4/100$
decimal 0.04
percent 4

1)

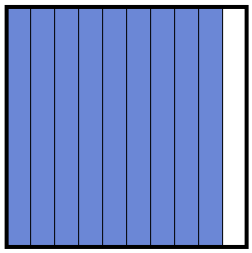

fraction $9/10$
decimal 0.9
percent 90

2)



fraction $8/10$
decimal 0.8
percent 80

3)



fraction $3/10$
decimal 0.3
percent 30

4)

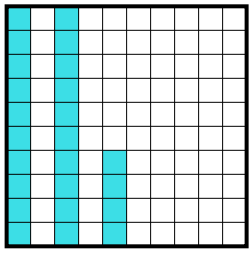

fraction $24/100$
decimal 0.24
percent 24

5)

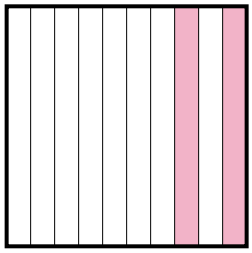

fraction $2/10$
decimal 0.2
percent 20

6)

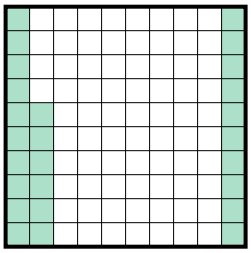

fraction $26/100$
decimal 0.26
percent 26

7)

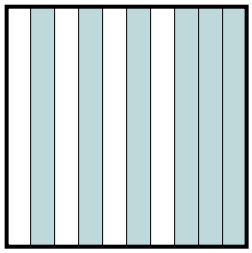

fraction $6/10$
decimal 0.6
percent 60

8)

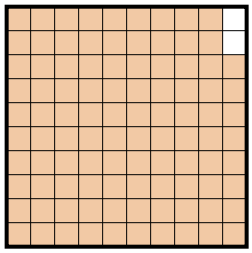

fraction $98/100$
decimal 0.98
percent 98

9)

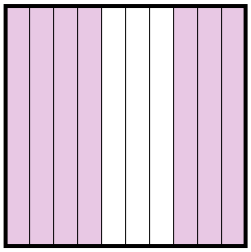

fraction $7/10$
decimal 0.7
percent 70

10)

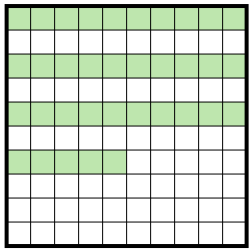

fraction $35/100$
decimal 0.35
percent 35

11)

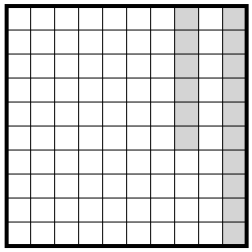

fraction $16/100$
decimal 0.16
percent 16

Answers

Ex.	$4/100$	0.04	4%
1.	$9/10$	0.9	90%
2.	$8/10$	0.8	80%
3.	$3/10$	0.3	30%
4.	$24/100$	0.24	24%
5.	$2/10$	0.2	20%
6.	$26/100$	0.26	26%
7.	$6/10$	0.6	60%
8.	$98/100$	0.98	98%
9.	$7/10$	0.7	70%
10.	$35/100$	0.35	35%
11.	$16/100$	0.16	16%

1-10	91	82	73	64	55	45	36	27	18	9
11	0									

Fraction, Decimal & Percent (Visual)

Name:

Determine the value written as a fraction , decimal & a percent.

Ex)



fraction $^{9}/_{10}$
decimal 0.9
percent 90

1)



fraction _____
decimal _____
percent _____

2)

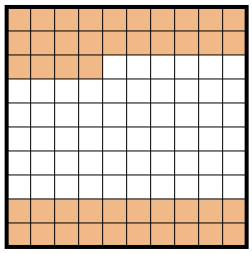

fraction _____
decimal _____
percent _____

3)

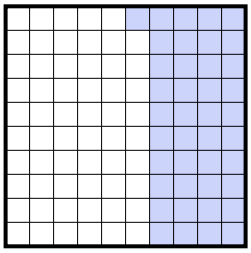

fraction _____
decimal _____
percent _____

4)



fraction _____
decimal _____
percent _____

5)

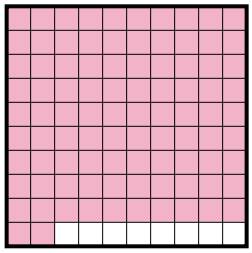

fraction _____
decimal _____
percent _____

6)

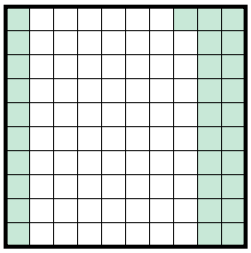

fraction _____
decimal _____
percent _____

7)

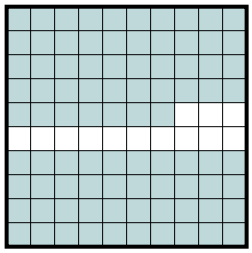

fraction _____
decimal _____
percent _____

8)

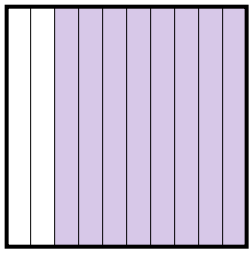

fraction _____
decimal _____
percent _____

9)

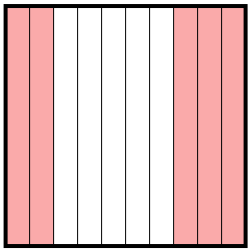

fraction _____
decimal _____
percent _____

10)

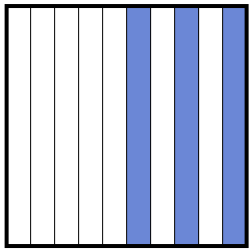

fraction _____
decimal _____
percent _____

11)

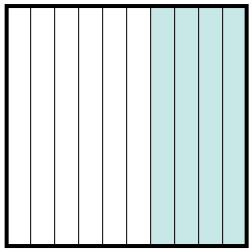

fraction _____
decimal _____
percent _____

Answers

Ex.	$^{9}/_{10}$	0.9	90%
1.			
2.			
3.			
4.			
5.			
6.			
7.			
8.			
9.			
10.			
11.			

1-10	91	82	73	64	55	45	36	27	18	9
11	0									

Fraction, Decimal & Percent (Visual) Name: **Answer Key**

Determine the value written as a fraction , decimal & a percent.

Ex)



fraction $\frac{9}{10}$
decimal 0.9
percent 90

1)



fraction $\frac{2}{10}$
decimal 0.2
percent 20

2)

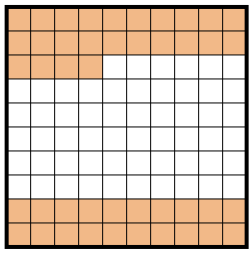

fraction $\frac{44}{100}$
decimal 0.44
percent 44

3)

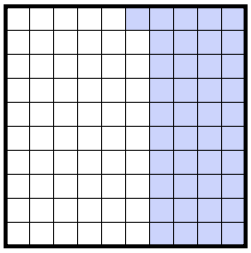

fraction $\frac{41}{100}$
decimal 0.41
percent 41

4)



fraction $\frac{6}{10}$
decimal 0.6
percent 60

5)

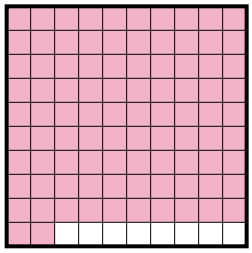

fraction $\frac{92}{100}$
decimal 0.92
percent 92

6)

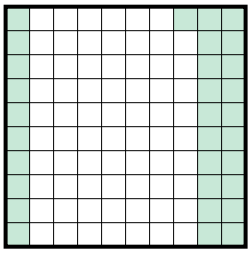

fraction $\frac{31}{100}$
decimal 0.31
percent 31

7)

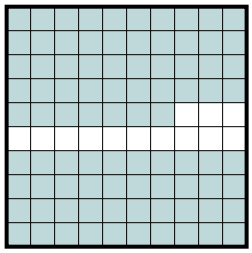

fraction $\frac{87}{100}$
decimal 0.87
percent 87

8)

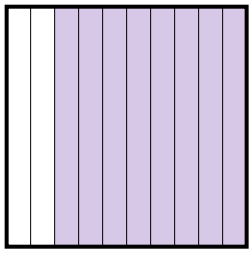

fraction $\frac{8}{10}$
decimal 0.8
percent 80

9)

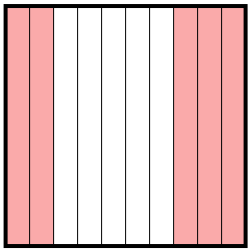

fraction $\frac{5}{10}$
decimal 0.5
percent 50

10)

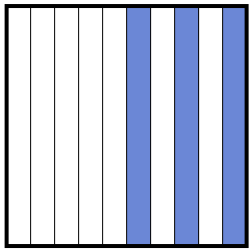

fraction $\frac{3}{10}$
decimal 0.3
percent 30

11)

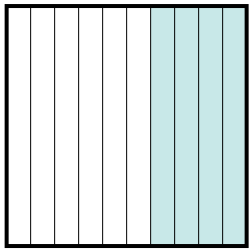

fraction $\frac{4}{10}$
decimal 0.4
percent 40

Answers

Ex.	$\frac{9}{10}$	0.9	90%
1.	$\frac{2}{10}$	0.2	20%
2.	$\frac{44}{100}$	0.44	44%
3.	$\frac{41}{100}$	0.41	41%
4.	$\frac{6}{10}$	0.6	60%
5.	$\frac{92}{100}$	0.92	92%
6.	$\frac{31}{100}$	0.31	31%
7.	$\frac{87}{100}$	0.87	87%
8.	$\frac{8}{10}$	0.8	80%
9.	$\frac{5}{10}$	0.5	50%
10.	$\frac{3}{10}$	0.3	30%
11.	$\frac{4}{10}$	0.4	40%

1-10	91	82	73	64	55	45	36	27	18	9
11	0									

Fraction, Decimal & Percent (Visual)

Name:

Determine the value written as a fraction , decimal & a percent.

Ex)



fraction $^{86}/_{100}$
decimal 0.86
percent 86

1)

fraction _____
decimal _____
percent _____

2)

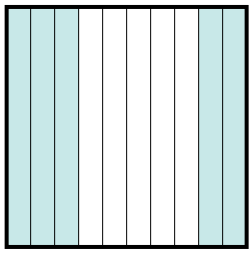

fraction _____
decimal _____
percent _____

3)

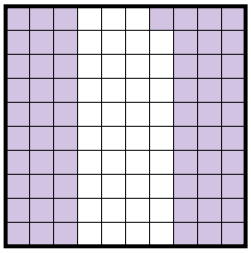

fraction _____
decimal _____
percent _____

4)

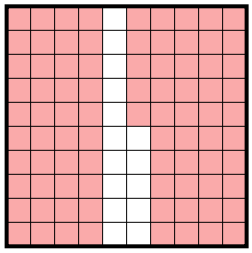

fraction _____
decimal _____
percent _____

5)

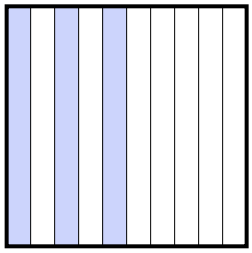

fraction _____
decimal _____
percent _____

6)

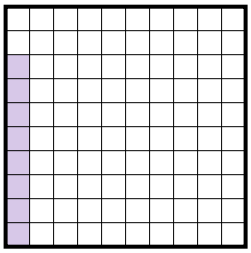

fraction _____
decimal _____
percent _____

7)

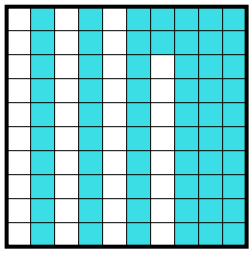

fraction _____
decimal _____
percent _____

8)

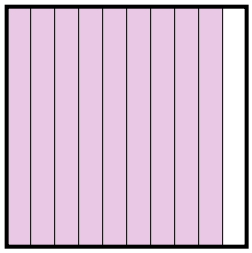

fraction _____
decimal _____
percent _____

9)

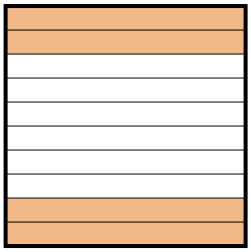

fraction _____
decimal _____
percent _____

10)

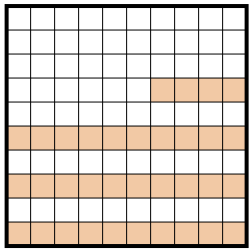

fraction _____
decimal _____
percent _____

11)



fraction _____
decimal _____
percent _____

Answers

Ex.	$^{86}/_{100}$	0.86	86%
1.			
2.			
3.			
4.			
5.			
6.			
7.			
8.			
9.			
10.			
11.			

1-10	91	82	73	64	55	45	36	27	18	9
11	0									

Fraction, Decimal & Percent (Visual) Name: **Answer Key**

Determine the value written as a fraction , decimal & a percent.

Ex)



fraction $^{86}/_{100}$
decimal 0.86
percent 86

1)

fraction $^{2}/_{10}$
decimal 0.2
percent 20

2)

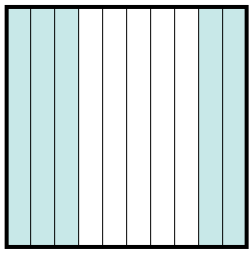

fraction $^{5}/_{10}$
decimal 0.5
percent 50

3)

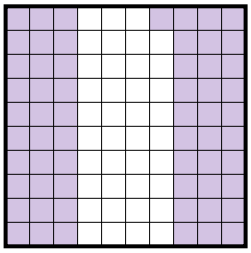

fraction $^{61}/_{100}$
decimal 0.61
percent 61

4)

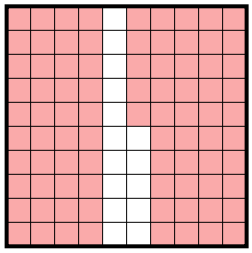

fraction $^{85}/_{100}$
decimal 0.85
percent 85

5)

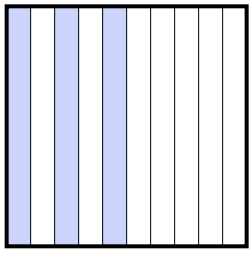

fraction $^{3}/_{10}$
decimal 0.3
percent 30

6)

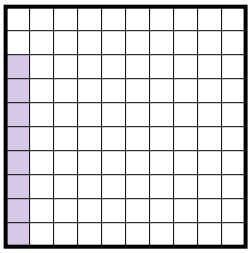

fraction $^{8}/_{100}$
decimal 0.08
percent 8

7)

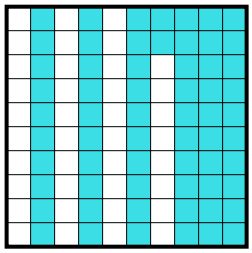

fraction $^{62}/_{100}$
decimal 0.62
percent 62

8)

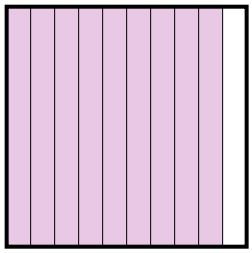

fraction $^{9}/_{10}$
decimal 0.9
percent 90

9)

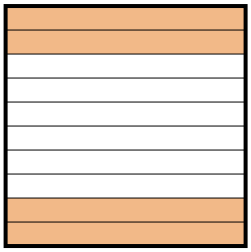

fraction $^{4}/_{10}$
decimal 0.4
percent 40

10)

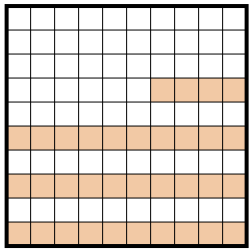

fraction $^{34}/_{100}$
decimal 0.34
percent 34

11)



fraction $^{7}/_{10}$
decimal 0.7
percent 70

Answers

Ex.	$^{86}/_{100}$	0.86	86%
1.	$^{2}/_{10}$	0.2	20%
2.	$^{5}/_{10}$	0.5	50%
3.	$^{61}/_{100}$	0.61	61%
4.	$^{85}/_{100}$	0.85	85%
5.	$^{3}/_{10}$	0.3	30%
6.	$^{8}/_{100}$	0.08	8%
7.	$^{62}/_{100}$	0.62	62%
8.	$^{9}/_{10}$	0.9	90%
9.	$^{4}/_{10}$	0.4	40%
10.	$^{34}/_{100}$	0.34	34%
11.	$^{7}/_{10}$	0.7	70%

1-10	91	82	73	64	55	45	36	27	18	9
11	0									

Fraction, Decimal & Percent (Visual)

Name:

Determine the value written as a fraction , decimal & a percent.

Ex)

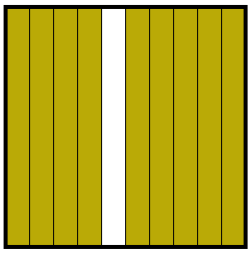

fraction $^{9}/_{10}$
decimal 0.9
percent 90

1)

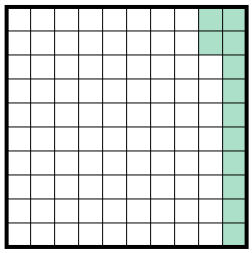

fraction _____
decimal _____
percent _____

2)

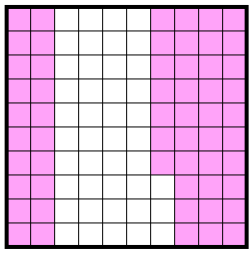

fraction _____
decimal _____
percent _____

3)

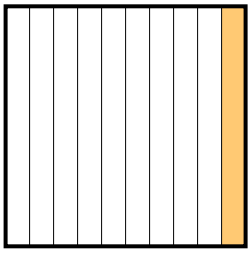

fraction _____
decimal _____
percent _____

4)

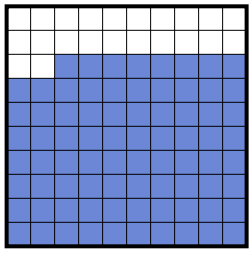

fraction _____
decimal _____
percent _____

5)

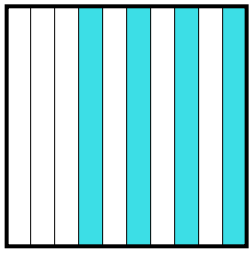

fraction _____
decimal _____
percent _____

6)

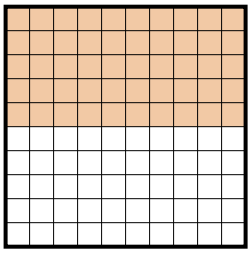

fraction _____
decimal _____
percent _____

7)

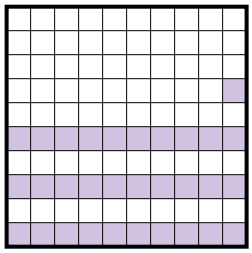

fraction _____
decimal _____
percent _____

8)

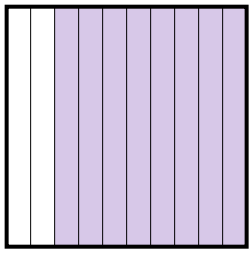

fraction _____
decimal _____
percent _____

9)

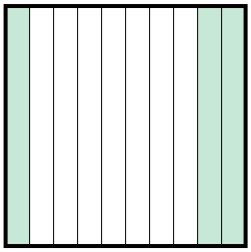

fraction _____
decimal _____
percent _____

10)

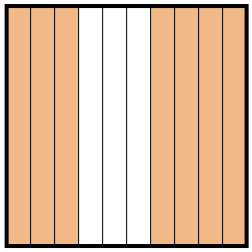

fraction _____
decimal _____
percent _____

11)

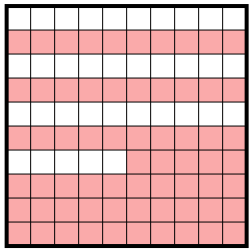

fraction _____
decimal _____
percent _____

Answers

Ex.	$^{9}/_{10}$	0.9	90%
1.			
2.			
3.			
4.			
5.			
6.			
7.			
8.			
9.			
10.			
11.			

1-10	91	82	73	64	55	45	36	27	18	9
11	0									

Fraction, Decimal & Percent (Visual) Name: **Answer Key**

Determine the value written as a fraction , decimal & a percent.

Ex)

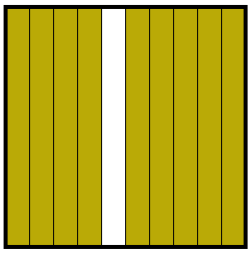

fraction $^{9}/_{10}$
decimal 0.9
percent 90

1)

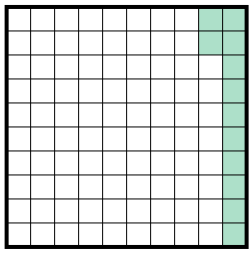

fraction $^{12}/_{100}$
decimal 0.12
percent 12

2)

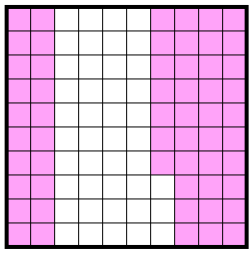

fraction $^{57}/_{100}$
decimal 0.57
percent 57

3)

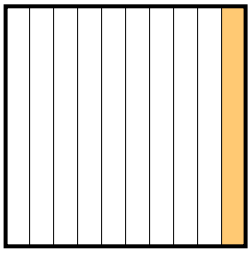

fraction $^{1}/_{10}$
decimal 0.1
percent 10

4)

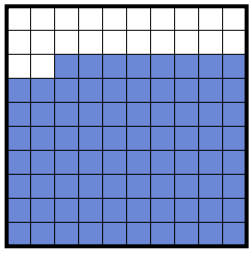

fraction $^{78}/_{100}$
decimal 0.78
percent 78

5)

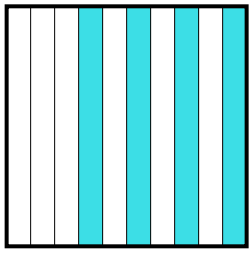

fraction $^{4}/_{10}$
decimal 0.4
percent 40

6)

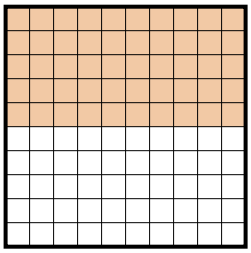

fraction $^{50}/_{100}$
decimal 0.50
percent 50

7)

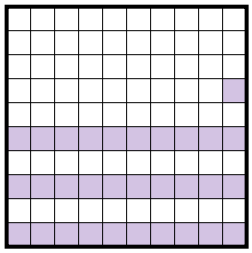

fraction $^{31}/_{100}$
decimal 0.31
percent 31

8)

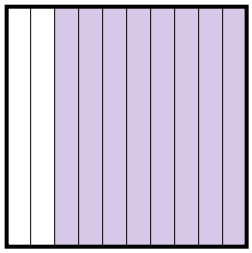

fraction $^{8}/_{10}$
decimal 0.8
percent 80

9)

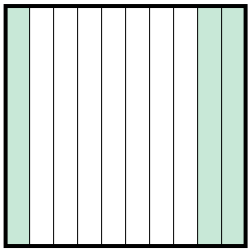

fraction $^{3}/_{10}$
decimal 0.3
percent 30

10)

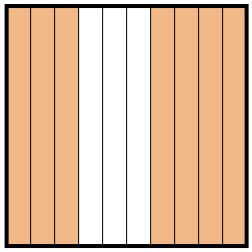

fraction $^{7}/_{10}$
decimal 0.7
percent 70

11)

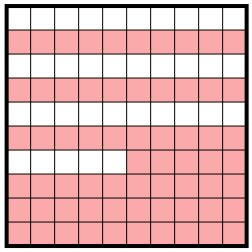

fraction $^{65}/_{100}$
decimal 0.65
percent 65

Answers

Ex.	$^{9}/_{10}$	0.9	90%
1.	$^{12}/_{100}$	0.12	12%
2.	$^{57}/_{100}$	0.57	57%
3.	$^{1}/_{10}$	0.1	10%
4.	$^{78}/_{100}$	0.78	78%
5.	$^{4}/_{10}$	0.4	40%
6.	$^{50}/_{100}$	0.50	50%
7.	$^{31}/_{100}$	0.31	31%
8.	$^{8}/_{10}$	0.8	80%
9.	$^{3}/_{10}$	0.3	30%
10.	$^{7}/_{10}$	0.7	70%
11.	$^{65}/_{100}$	0.65	65%

1-10	91	82	73	64	55	45	36	27	18	9
11	0									

Fraction, Decimal & Percent (Visual)

Name:

Determine the value written as a fraction , decimal & a percent.

Ex)

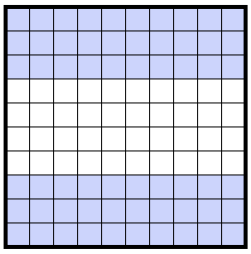

fraction $^{60}/_{100}$
decimal 0.60
percent 60

1)

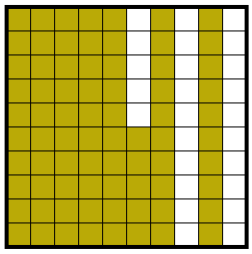

fraction _____
decimal _____
percent _____

2)

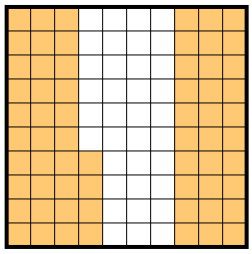

fraction _____
decimal _____
percent _____

3)

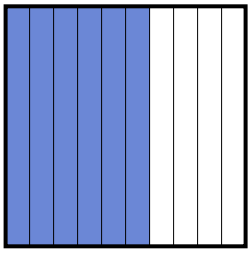

fraction _____
decimal _____
percent _____

4)

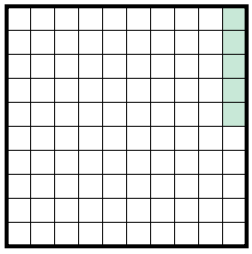

fraction _____
decimal _____
percent _____

5)

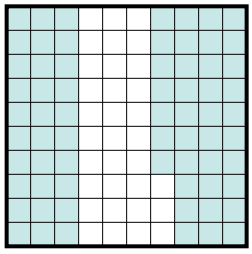

fraction _____
decimal _____
percent _____

6)

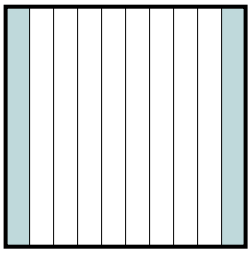

fraction _____
decimal _____
percent _____

7)

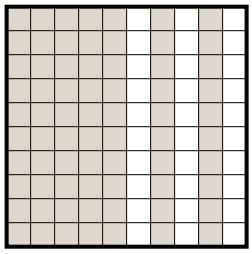

fraction _____
decimal _____
percent _____

8)

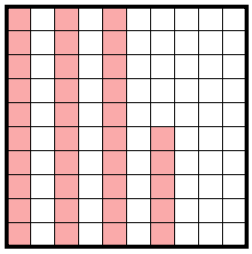

fraction _____
decimal _____
percent _____

9)



fraction _____
decimal _____
percent _____

10)



fraction _____
decimal _____
percent _____

11)

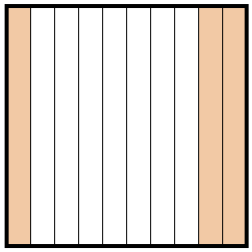

fraction _____
decimal _____
percent _____

Answers

Ex.	$^{60}/_{100}$	0.60	60%
1.			
2.			
3.			
4.			
5.			
6.			
7.			
8.			
9.			
10.			
11.			

1-10	91	82	73	64	55	45	36	27	18	9
11	0									

Fraction, Decimal & Percent (Visual) Name: **Answer Key**

Determine the value written as a fraction , decimal & a percent.

Ex)

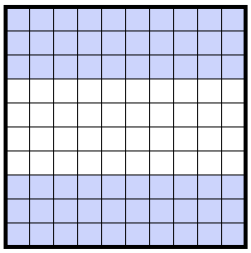

fraction $\frac{60}{100}$
decimal 0.60
percent 60

1)

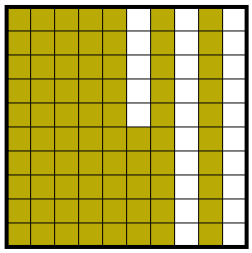

fraction $\frac{75}{100}$
decimal 0.75
percent 75

2)

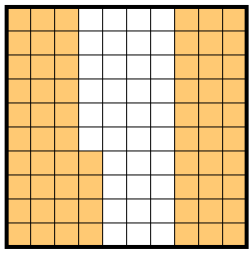

fraction $\frac{64}{100}$
decimal 0.64
percent 64

3)

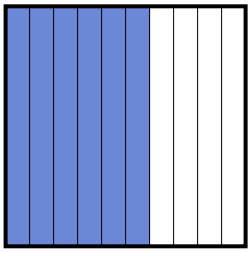

fraction $\frac{6}{10}$
decimal 0.6
percent 60

4)

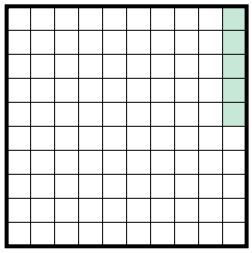

fraction $\frac{5}{100}$
decimal 0.05
percent 5

5)

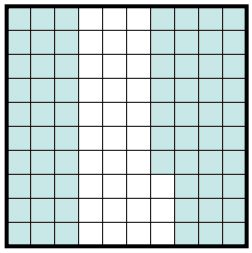

fraction $\frac{67}{100}$
decimal 0.67
percent 67

6)

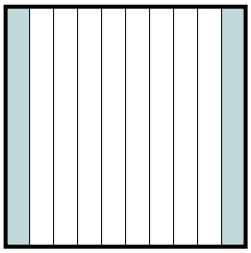

fraction $\frac{2}{10}$
decimal 0.2
percent 20

7)

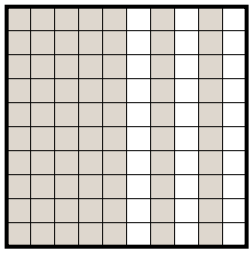

fraction $\frac{70}{100}$
decimal 0.70
percent 70

8)

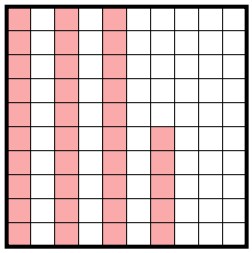

fraction $\frac{35}{100}$
decimal 0.35
percent 35

9)



fraction $\frac{9}{10}$
decimal 0.9
percent 90

10)



fraction $\frac{8}{10}$
decimal 0.8
percent 80

11)

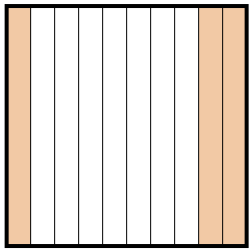

fraction $\frac{3}{10}$
decimal 0.3
percent 30

Answers

Ex.	$\frac{60}{100}$	0.60	60%
1.	$\frac{75}{100}$	0.75	75%
2.	$\frac{64}{100}$	0.64	64%
3.	$\frac{6}{10}$	0.6	60%
4.	$\frac{5}{100}$	0.05	5%
5.	$\frac{67}{100}$	0.67	67%
6.	$\frac{2}{10}$	0.2	20%
7.	$\frac{70}{100}$	0.70	70%
8.	$\frac{35}{100}$	0.35	35%
9.	$\frac{9}{10}$	0.9	90%
10.	$\frac{8}{10}$	0.8	80%
11.	$\frac{3}{10}$	0.3	30%

1-10	91	82	73	64	55	45	36	27	18	9
11	0									