Fraction, Decimal & Percent (Visual)

Name:

Determine the value written as a fraction , decimal & a percent.

Ex)



fraction $^{3}/_{10}$
decimal 0.3
percent 30

1)

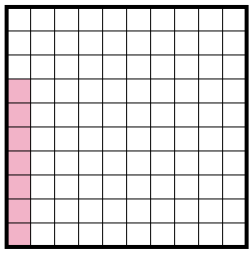

fraction _____
decimal _____
percent _____

2)

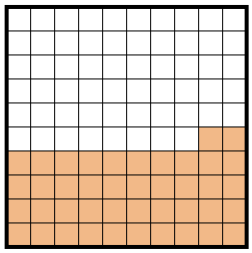

fraction _____
decimal _____
percent _____

3)

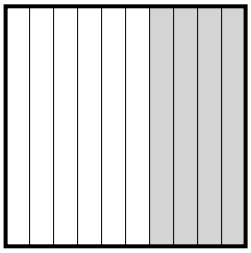

fraction _____
decimal _____
percent _____

4)

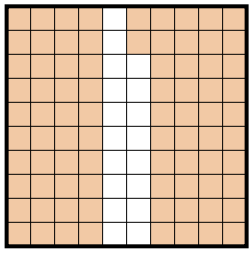

fraction _____
decimal _____
percent _____

5)

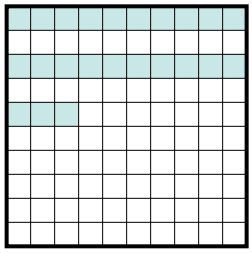

fraction _____
decimal _____
percent _____

6)

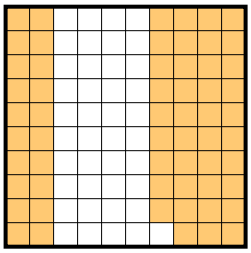

fraction _____
decimal _____
percent _____

7)

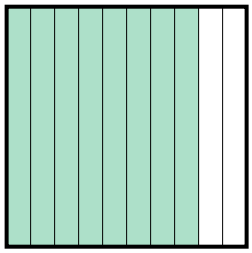

fraction _____
decimal _____
percent _____

8)

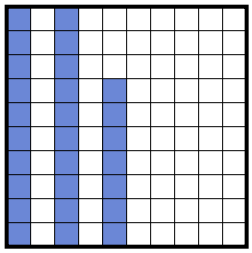

fraction _____
decimal _____
percent _____

9)

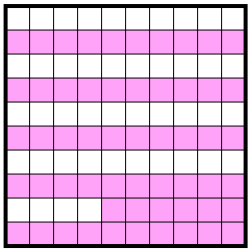

fraction _____
decimal _____
percent _____

10)

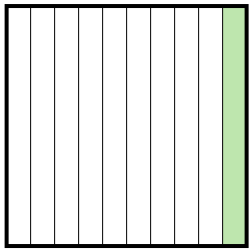

fraction _____
decimal _____
percent _____

11)



fraction _____
decimal _____
percent _____

Answers

Ex.	$^{3}/_{10}$	0.3	30%
1.			
2.			
3.			
4.			
5.			
6.			
7.			
8.			
9.			
10.			
11.			

Fraction, Decimal & Percent (Visual) Name: **Answer Key**

Determine the value written as a fraction , decimal & a percent.

Ex)



fraction $^{3}/_{10}$
decimal 0.3
percent 30

1)

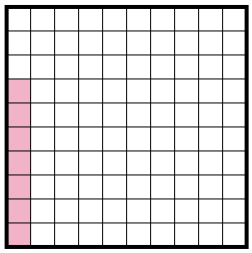

fraction $^{7}/_{100}$
decimal 0.07
percent 7

2)

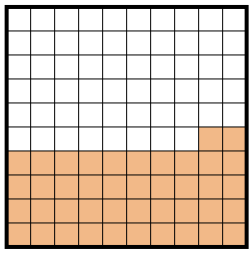

fraction $^{42}/_{100}$
decimal 0.42
percent 42

3)

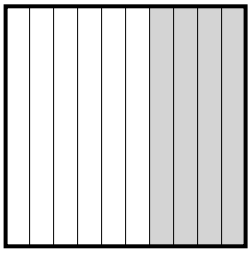

fraction $^{4}/_{10}$
decimal 0.4
percent 40

4)

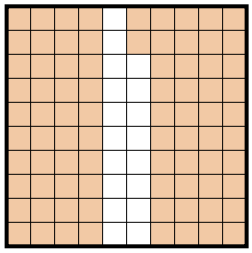

fraction $^{82}/_{100}$
decimal 0.82
percent 82

5)

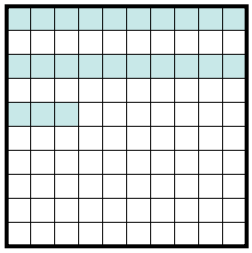

fraction $^{23}/_{100}$
decimal 0.23
percent 23

6)

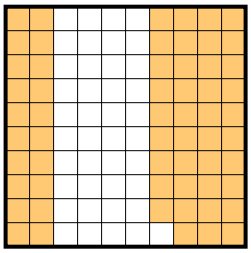

fraction $^{59}/_{100}$
decimal 0.59
percent 59

7)

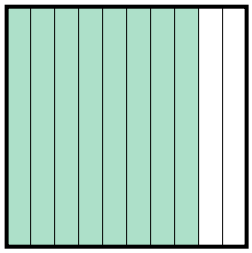

fraction $^{8}/_{10}$
decimal 0.8
percent 80

8)

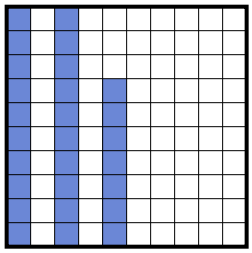

fraction $^{27}/_{100}$
decimal 0.27
percent 27

9)

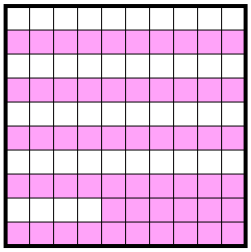

fraction $^{56}/_{100}$
decimal 0.56
percent 56

10)

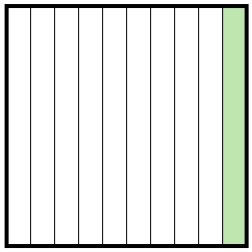

fraction $^{1}/_{10}$
decimal 0.1
percent 10

11)



fraction $^{9}/_{10}$
decimal 0.9
percent 90

Answers

Ex.	$^{3}/_{10}$	0.3	30%
1.	$^{7}/_{100}$	0.07	7%
2.	$^{42}/_{100}$	0.42	42%
3.	$^{4}/_{10}$	0.4	40%
4.	$^{82}/_{100}$	0.82	82%
5.	$^{23}/_{100}$	0.23	23%
6.	$^{59}/_{100}$	0.59	59%
7.	$^{8}/_{10}$	0.8	80%
8.	$^{27}/_{100}$	0.27	27%
9.	$^{56}/_{100}$	0.56	56%
10.	$^{1}/_{10}$	0.1	10%
11.	$^{9}/_{10}$	0.9	90%

1-10	91	82	73	64	55	45	36	27	18	9
11	0									