Dividing Unit Fractions (Visual)

Name:

Use the visual model to solve each problem.

$\frac{1}{3} \div 4 = ?$



To solve, start with a whole.

Split the whole into 3 pieces and fill in 1 section.

Now you can see the size of $\frac{1}{3}$

Next split $\frac{1}{3}$ into 4 groups.

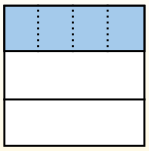

This shows the size of each piece.

To figure out the size of each piece in comparison to the whole, split the whole into 4 groups.

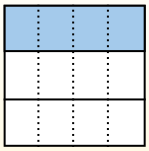

Each piece is $\frac{1}{12}$ of the whole. Or: $\frac{1}{3} \div 4 = \frac{1}{12}$

1) $\frac{1}{3} \div 3 =$

2) $\frac{1}{6} \div 7 =$

3) $\frac{1}{8} \div 6 =$

4) $\frac{1}{4} \div 4 =$

5) $\frac{1}{6} \div 5 =$

6) $\frac{1}{2} \div 4 =$

7) $\frac{1}{2} \div 3 =$

8) $\frac{1}{9} \div 4 =$

9) $\frac{1}{9} \div 3 =$

10) $\frac{1}{3} \div 2 =$

11) $\frac{1}{3} \div 5 =$

12) $\frac{1}{8} \div 9 =$

Answers

1. _____
2. _____
3. _____
4. _____
5. _____
6. _____
7. _____
8. _____
9. _____
10. _____
11. _____
12. _____

1-10	92	83	75	67	58	50	42	33	25	17
11-12	8	0								

Dividing Unit Fractions (Visual) Name: **Answer Key**

Use the visual model to solve each problem.

$\frac{1}{3} \div 4 = ?$



To solve, start with a whole.

Split the whole into 3 pieces and fill in 1 section.

Now you can see the size of $\frac{1}{3}$

Next split $\frac{1}{3}$ into 4 groups.

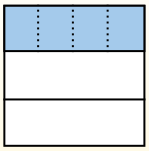

This shows the size of each piece.

To figure out the size of each piece in comparison to the whole, split the whole into 4 groups.

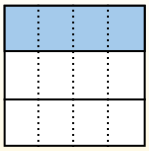

Each piece is $\frac{1}{12}$ of the whole. Or: $\frac{1}{3} \div 4 = \frac{1}{12}$

1) $\frac{1}{3} \div 3 =$

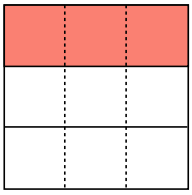

2) $\frac{1}{6} \div 7 =$

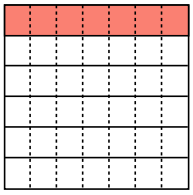

3) $\frac{1}{8} \div 6 =$

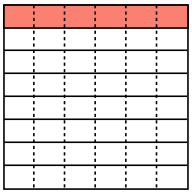

4) $\frac{1}{4} \div 4 =$

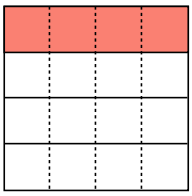

5) $\frac{1}{6} \div 5 =$

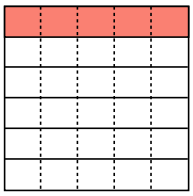

6) $\frac{1}{2} \div 4 =$

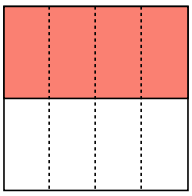

7) $\frac{1}{2} \div 3 =$

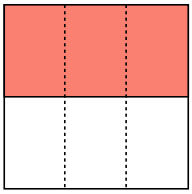

8) $\frac{1}{9} \div 4 =$

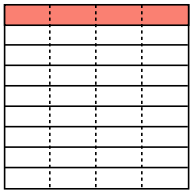

9) $\frac{1}{9} \div 3 =$

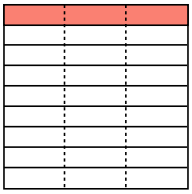

10) $\frac{1}{3} \div 2 =$

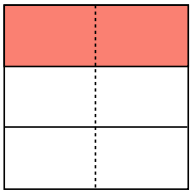

11) $\frac{1}{3} \div 5 =$

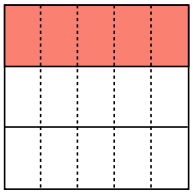

12) $\frac{1}{8} \div 9 =$

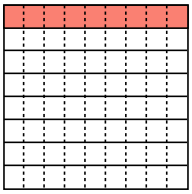

Answers

1. $\frac{1}{9}$
2. $\frac{1}{42}$
3. $\frac{1}{48}$
4. $\frac{1}{16}$
5. $\frac{1}{30}$
6. $\frac{1}{8}$
7. $\frac{1}{6}$
8. $\frac{1}{36}$
9. $\frac{1}{27}$
10. $\frac{1}{6}$
11. $\frac{1}{15}$
12. $\frac{1}{72}$

1-10	92	83	75	67	58	50	42	33	25	17
11-12	8	0								