Dividing Unit Fractions with a Numberline

Name:

Use the numberline to solve each problem. The first is marked for you.

1) $\frac{1}{5} \div 5$



2) $\frac{1}{7} \div 3$



3) $\frac{1}{7} \div 2$



4) $\frac{1}{7} \div 5$



5) $\frac{1}{4} \div 6$

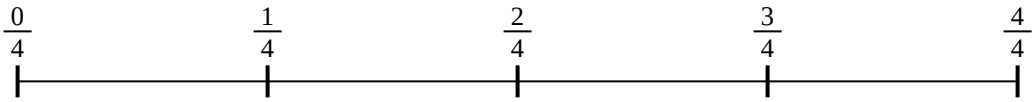

6) $\frac{1}{6} \div 3$

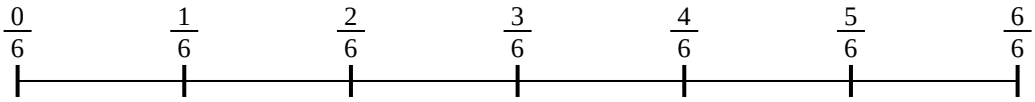

7) $\frac{1}{6} \div 4$

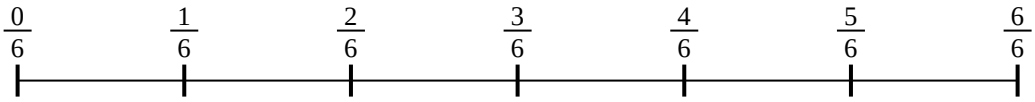

8) $\frac{1}{3} \div 6$



9) $\frac{1}{5} \div 2$



Answers

1. _____
2. _____
3. _____
4. _____
5. _____
6. _____
7. _____
8. _____
9. _____

1-9	89	78	67	56	44	33	22	11	0

Dividing Unit Fractions with a Numberline Name: **Answer Key**

Use the numberline to solve each problem. The first is marked for you.

1) $\frac{1}{5} \div 5$

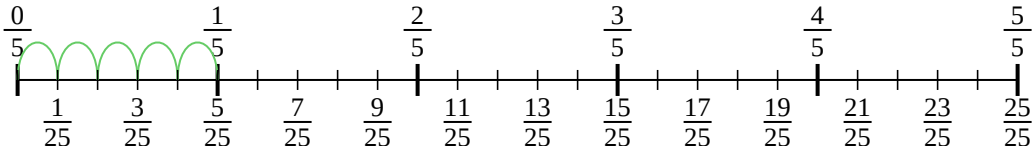

2) $\frac{1}{7} \div 3$

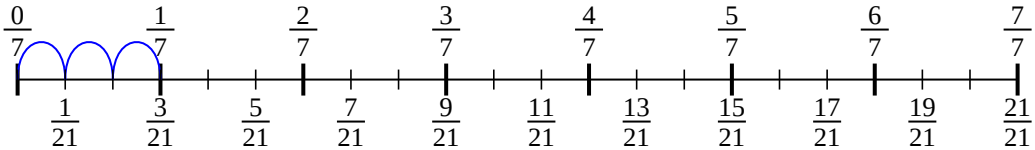

3) $\frac{1}{7} \div 2$

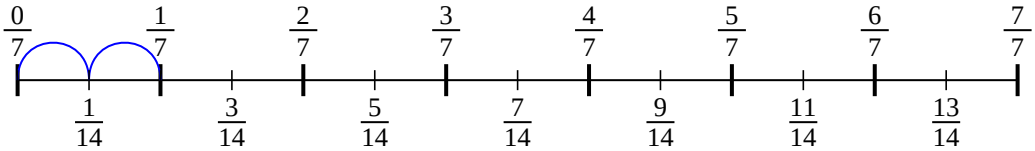

4) $\frac{1}{7} \div 5$

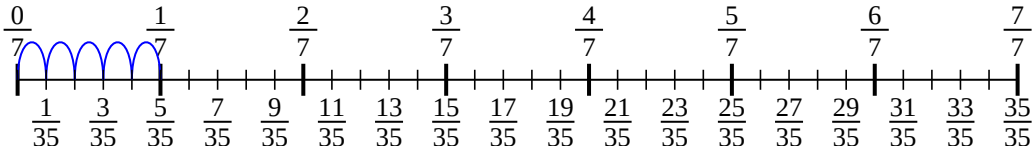

5) $\frac{1}{4} \div 6$

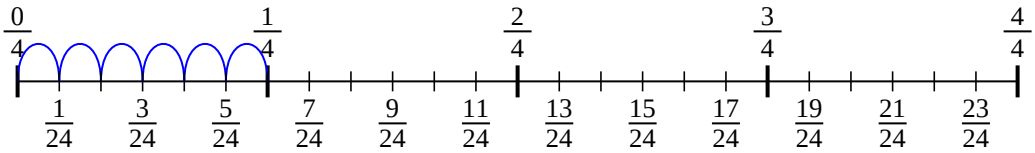

6) $\frac{1}{6} \div 3$

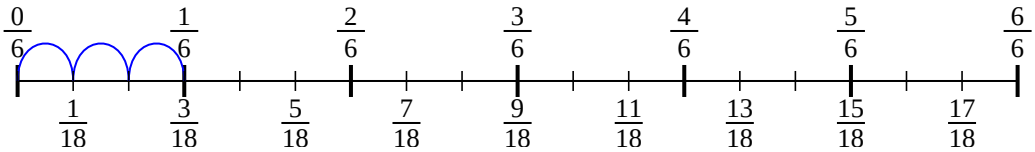

7) $\frac{1}{6} \div 4$

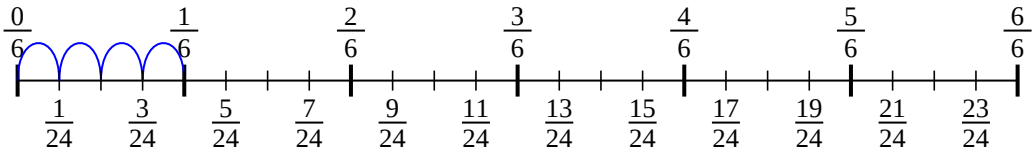

8) $\frac{1}{3} \div 6$

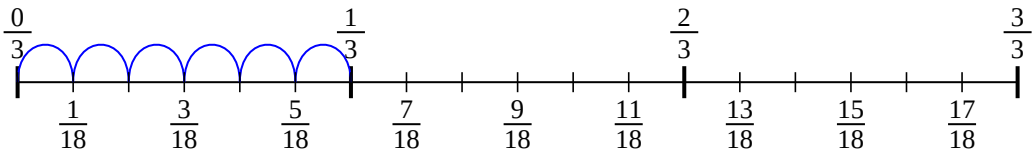

9) $\frac{1}{5} \div 2$

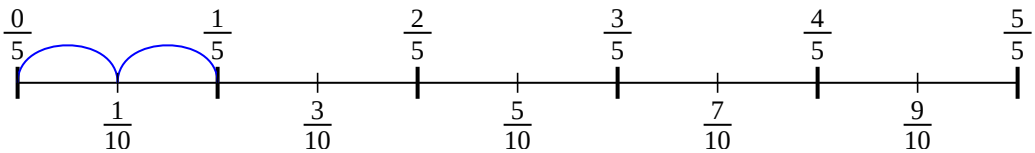

Answers

1. $\frac{1}{25}$
2. $\frac{1}{21}$
3. $\frac{1}{14}$
4. $\frac{1}{35}$
5. $\frac{1}{24}$
6. $\frac{1}{18}$
7. $\frac{1}{24}$
8. $\frac{1}{18}$
9. $\frac{1}{10}$

1-9	89	78	67	56	44	33	22	11	0

Dividing Unit Fractions with a Numberline

Name:

Use the numberline to solve each problem. The first is marked for you.

$1/18$	$1/35$	$1/18$	$1/21$
$1/24$	$1/14$	$1/10$	$1/25$
$1/24$			

1) $1/5 \div 5$



2) $1/7 \div 3$



3) $1/7 \div 2$



4) $1/7 \div 5$



5) $1/4 \div 6$

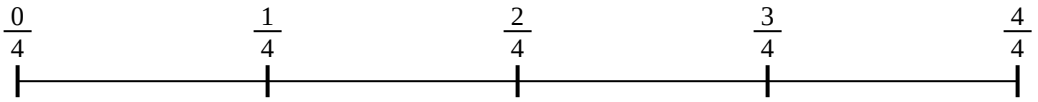

6) $1/6 \div 3$

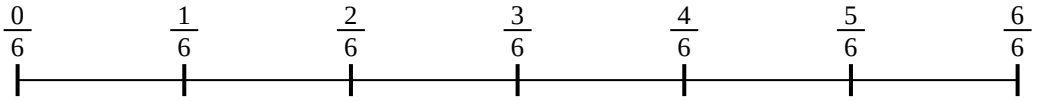

7) $1/6 \div 4$

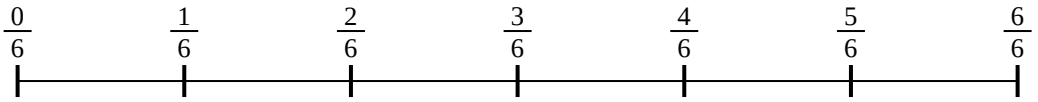

8) $1/3 \div 6$



9) $1/5 \div 2$



Answers

1. _____
2. _____
3. _____
4. _____
5. _____
6. _____
7. _____
8. _____
9. _____

1-9	89	78	67	56	44	33	22	11	0