Rewriting Multiplication Problems (visual)

Name:

Write each array as a multiplication problem and solve.

Ex) 

1) 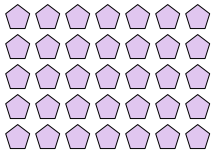

2) 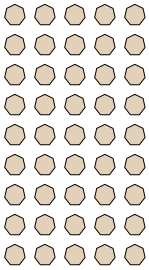

3)

4) 

5) 

6) 

7) 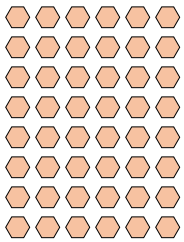

8)

9) 

10) 

11) 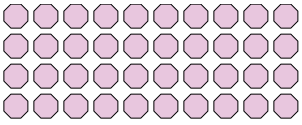

Answers

Ex. 5 × 5 = 25

1. _____
2. _____
3. _____
4. _____
5. _____
6. _____
7. _____
8. _____
9. _____
10. _____
11. _____

Rewriting Multiplication Problems (visual) Name: **Answer Key**

Write each array as a multiplication problem and solve.

Ex) 

1) 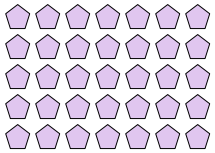

2) 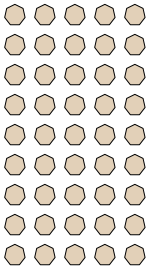

3)

4) 

5) 

6) 

7) 

8)

9) 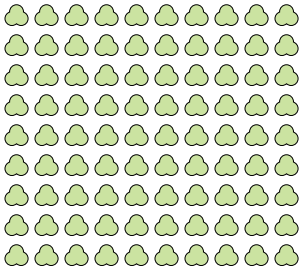

10) 

11) 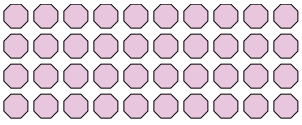

Answers

Ex. 5 × 5 = 25

1. 5 × 7 = 35

2. 9 × 5 = 45

3. 6 × 9 = 54

4. 10 × 5 = 50

5. 7 × 4 = 28

6. 6 × 5 = 30

7. 8 × 6 = 48

8. 2 × 6 = 12

9. 9 × 10 = 90

10. 7 × 3 = 21

11. 4 × 10 = 40

1-10	91	82	73	64	55	45	36	27	18	9
11	0									