Rewriting Multiplication Problems (visual)

Name:

Write each array as a multiplication problem and solve.

Ex)



1)



2)



3)



4)

5)

6)



7)

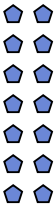

8)



9)

10)

11)



Answers

Ex. **4 × 8 = 32**

1. _____
2. _____
3. _____
4. _____
5. _____
6. _____
7. _____
8. _____
9. _____
10. _____
11. _____

1-10	91	82	73	64	55	45	36	27	18	9
11	0									

Rewriting Multiplication Problems (visual) Name: **Answer Key**

Write each array as a multiplication problem and solve.

Ex)



1)



2)



3)



4)

5)

6)



7)

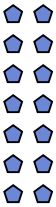

8)



9)

10)

11)



Answers

Ex. 4 × 8 = 32

1. 7 × 10 = 70
2. 10 × 7 = 70
3. 4 × 4 = 16
4. 3 × 3 = 9
5. 4 × 10 = 40
6. 10 × 5 = 50
7. 7 × 2 = 14
8. 3 × 8 = 24
9. 2 × 5 = 10
10. 6 × 2 = 12
11. 8 × 7 = 56

1-10	91	82	73	64	55	45	36	27	18	9
11	0									