Function Machines (Add & Subtract)

Name:

Determine the rule each function machine is using.

Ex)

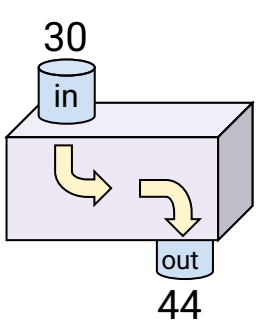

Add 14

1)

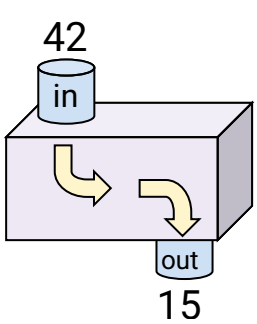

2)

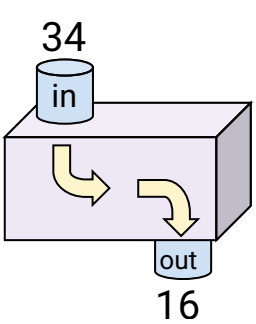

3)

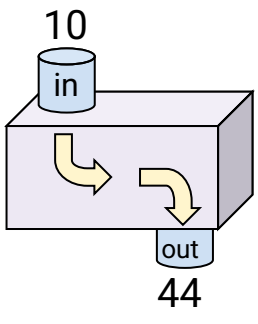

4)

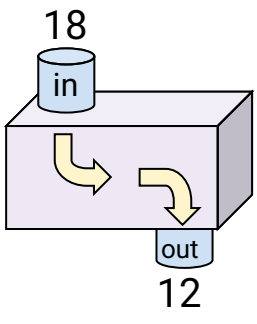

5)

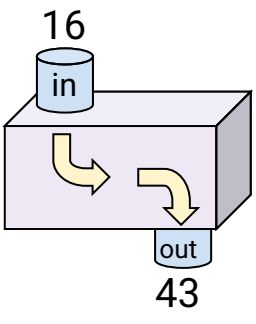

6)

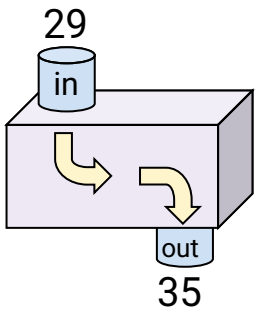

7)

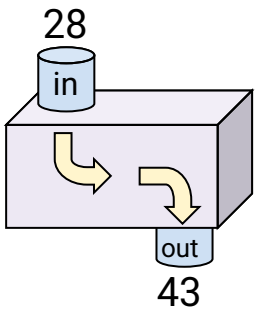

8)

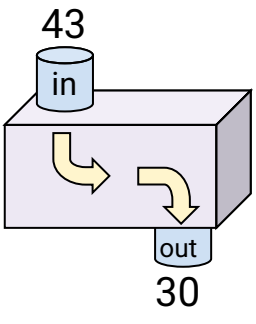

9)

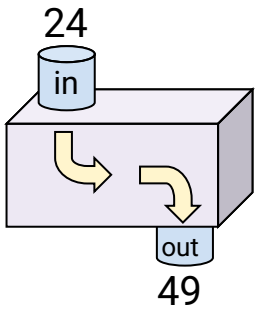

10)

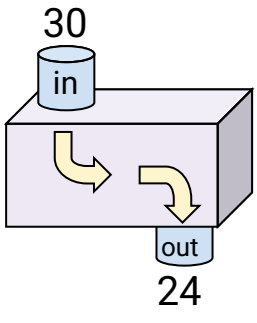

11)

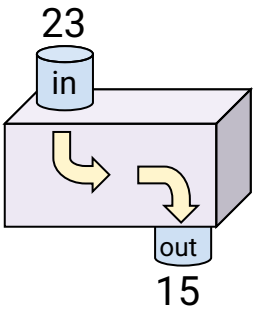

Answers

Ex. Add 14

1. _____
2. _____
3. _____
4. _____
5. _____
6. _____
7. _____
8. _____
9. _____
10. _____
11. _____

1-10	91	82	73	64	55	45	36	27	18	9
11	0									

Function Machines (Add & Subtract) Name: **Answer Key**

Determine the rule each function machine is using.

Ex)

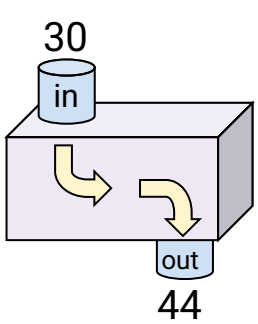

Add 14

1)

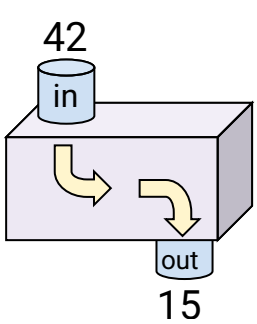

Subtract 27

2)

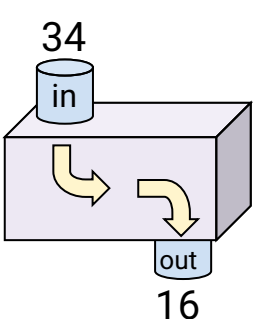

Subtract 18

3)

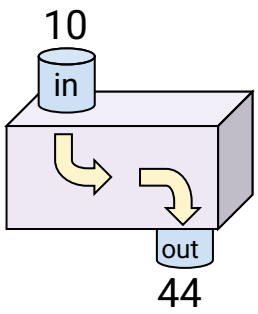

Add 34

4)

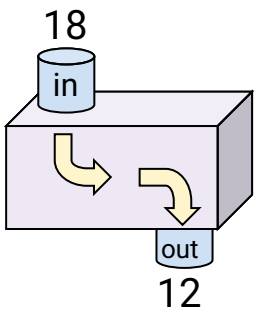

Subtract 6

5)

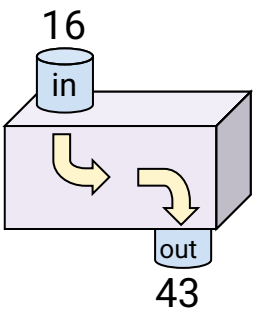

Add 27

6)

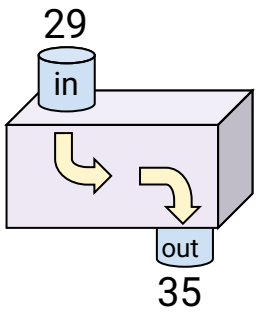

Add 6

7)

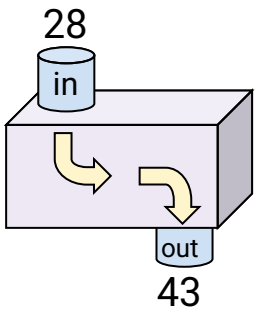

Add 15

8)

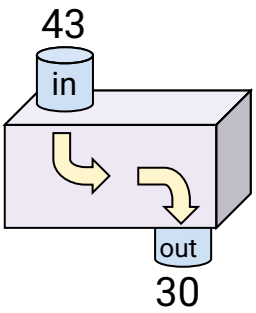

Subtract 13

9)

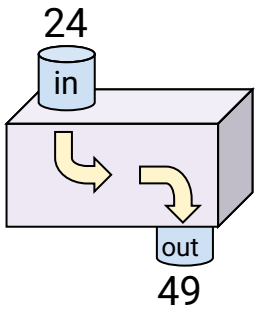

Add 25

10)

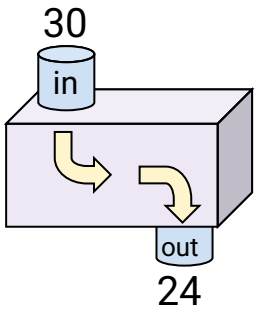

Subtract 6

11)

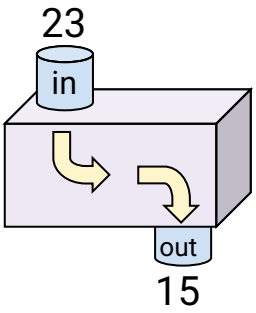

Subtract 8

Answers

Ex.	Add 14
1.	Subtract 27
2.	Subtract 18
3.	Add 34
4.	Subtract 6
5.	Add 27
6.	Add 6
7.	Add 15
8.	Subtract 13
9.	Add 25
10.	Subtract 6
11.	Subtract 8