Function Machines (Add & Subtract) Name:

Determine the rule each function machine is using.

Ex)

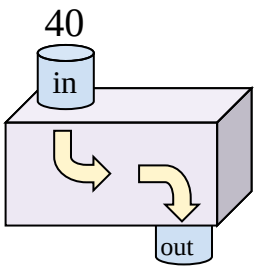

Subtract 24

1)

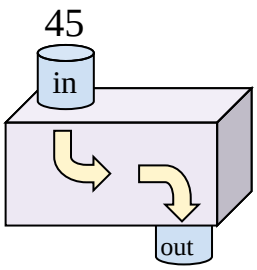

2)

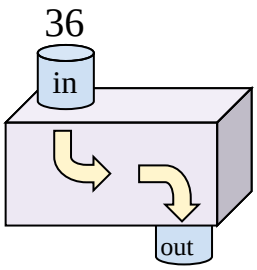

3)

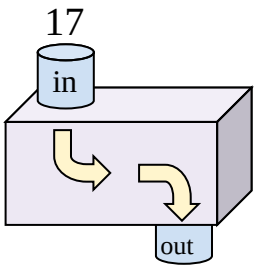

4)

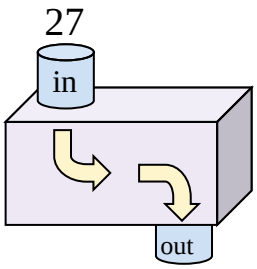

5)

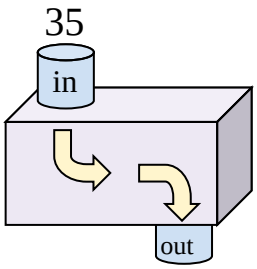

6)

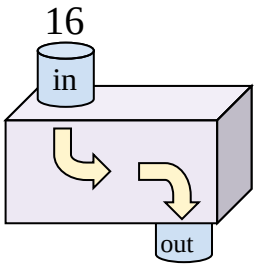

7)

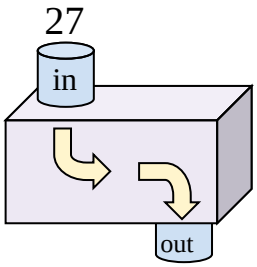

8)

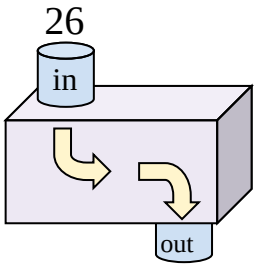

9)

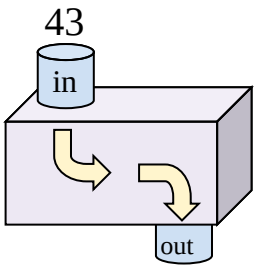

10)

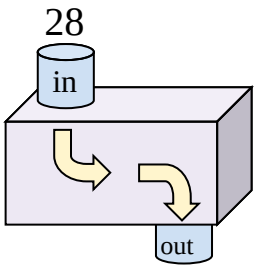

11)

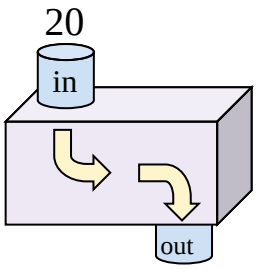

Answers

Ex. Subtract 24

1. _____
2. _____
3. _____
4. _____
5. _____
6. _____
7. _____
8. _____
9. _____
10. _____
11. _____

Function Machines (Add & Subtract) Name: **Answer Key**

Determine the rule each function machine is using.

Ex)

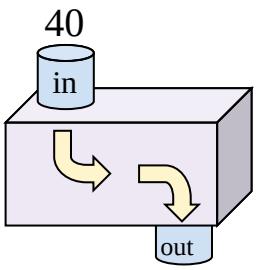

Subtract 24

1)

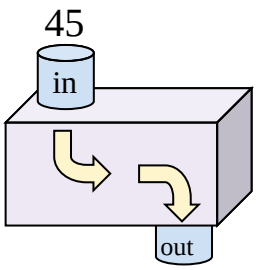

Subtract 18

2)

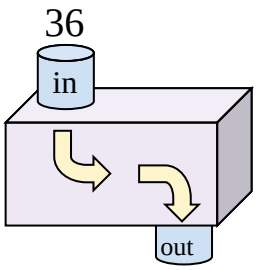

Subtract 11

3)

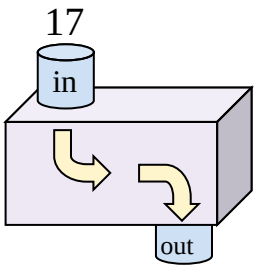

Subtract 6

4)

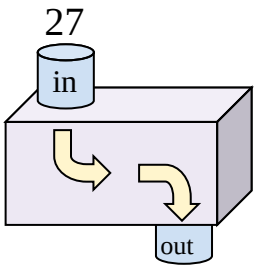

Add 10

5)

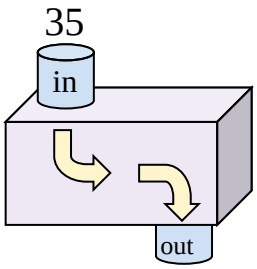

Subtract 5

6)

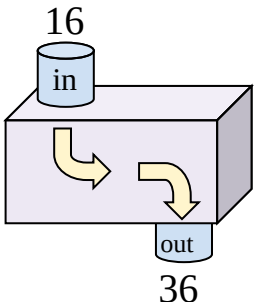

Add 20

7)

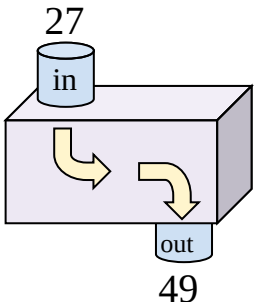

Add 22

8)

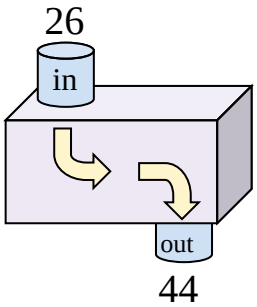

Add 18

9)

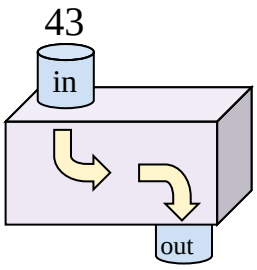

Subtract 27

10)

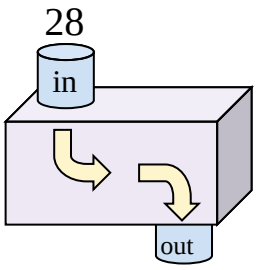

Add 14

11)

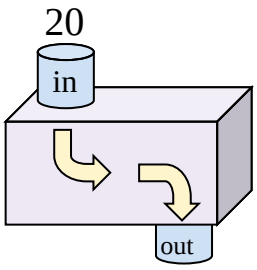

Subtract 7

Answers

Ex. Subtract 24

1. Subtract 18
2. Subtract 11
3. Subtract 6
4. Add 10
5. Subtract 5
6. Add 20
7. Add 22
8. Add 18
9. Subtract 27
10. Add 14
11. Subtract 7